Sometimes, Mum takes Sarah and Fatima to buy snacks.
After taking the snacks, they pay them with some money.

Sarah needs to pay 16 cents altogether.
She pays with one 10-cent coins, one 5-cent coins and one 1-cent coin

Fatima needs to pay 30 cents altogether.

She gives three 10-cent coins to the cashier.
Alhamdulillaah, they have some snacks to enjoy at home.

To be able to use coins like Sarah and Fatima.
Today, we are going to learn to pay with coins in cents.

Let's practise.

Write your answer in words. One has been done for you.

1) This hairband costs 4 cents .

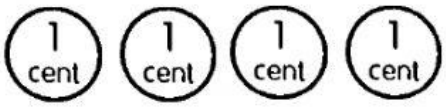

We can pay for it with four 1 - cent coins.

2) This pencil costs 12 cents.

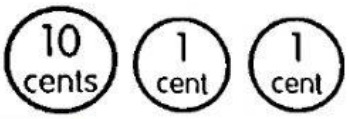

We can pay for it with _____ 10-cent coins and _____ 1-cent coins.

3) This bun costs 28 cents.

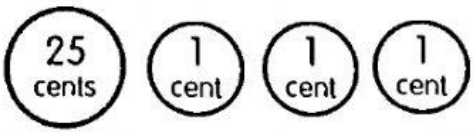

We can pay for it with _____ 25 -cent coins and _____ 1-cent coins.

4) Umar has this toy car. It costs 80 cents.



We can pay for it with _____ 50-cent coin and _____ 10-cent coins.

LIVEWORKSHEETS