MATEMÁTICAS – PROFE VLAD TOLEDO (repaso)

INSTRUCCIONES: Calcula el volumen y el área de las siguientes figuras: (DRAG & DROP)

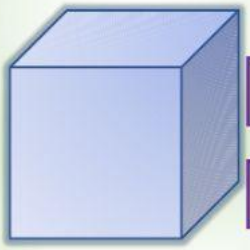

$-2x^2$

A=

V=

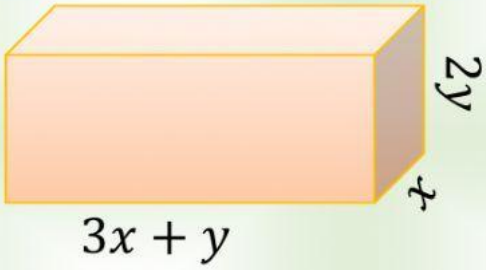

A= | V=

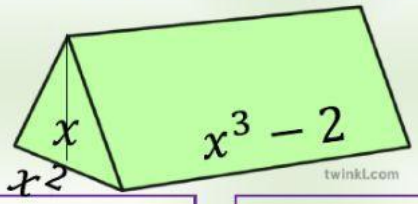

A= | V=

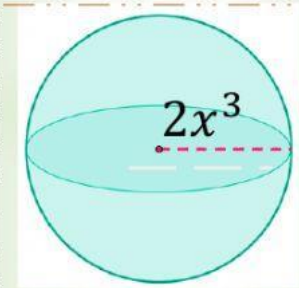

A=

V=

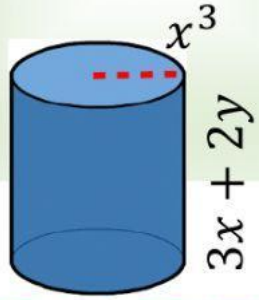

A=

V=

$3x^5 + x^3 - 6x^2$

$16x^6\pi$

$-8x^6$

$\frac{x^6}{2} - x^3$

$6x^2y + 2xy^2$

$\frac{32}{3}x^9\pi$

$(3x^7 + 2x^6y)\pi$

$(6x^4 + 4x^3y + 2x^6)\pi$

$6x^2 + 18xy + 4y^2$

$24x^4$

LIVEWORKSHEETS