Name: **Date:**

The circulatory system

1. **Write the name of the parts of the circulatory system:**

-Vein. Artery, Blood, Heart, Oxygen and Beats.

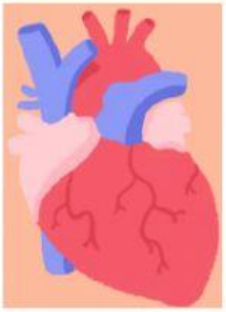

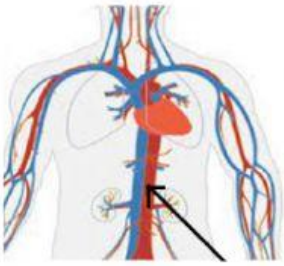

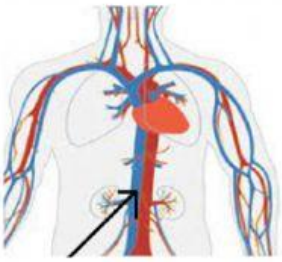

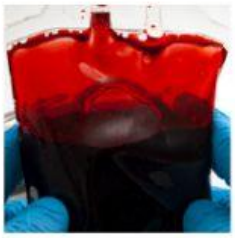

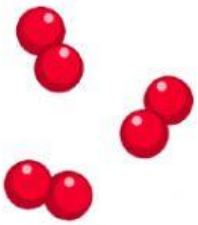

LIVEWORKSHEETS