MARTES 20/04/2021 | **AREA: MATEMÁTICAS**

TEMA: Números naturales hasta el 99

Actividades sincrónicas

Complete la familia de los números dados en orden secuencial:

Número 70

[ ] → 71 → [ ] → 73 → [ ] → [ ] → [ ] → [ ] → 78 → [ ]

[ ] ← [ ] ← [ ] ← [ ] ← [ ] ← [ ] ← 77 ← [ ] ← 79

Número 90

[ ] → [ ] → 90 → [ ] → [ ] → [ ] → [ ] → [ ] → [ ] → 99

[ ] ← 91 ← [ ] ← [ ] ← [ ] ← [ ] ← [ ] ← [ ] ← 98 ← [ ]

En el siguiente cuadro represente gráficamente el número:

78

Con base 10	Con ábaco	De manera simbólica

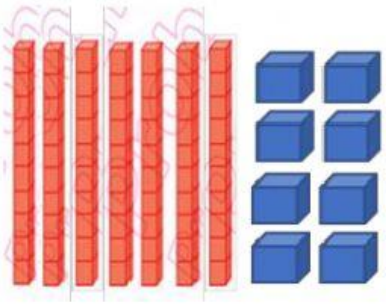

D	U
7	8



LIVEWORKSHEETS

En el siguiente cuadro represente gráficamente el número

64

Con base 10	Con ábaco	De manera simbólica



D	U
6	4

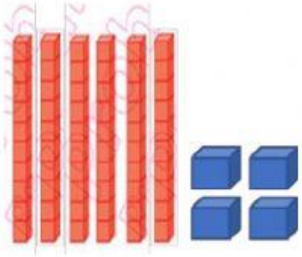

En el siguiente cuadro represente gráficamente el número:

82

Con base 10	Con ábaco	De manera simbólica

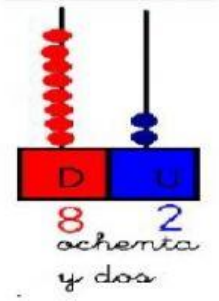

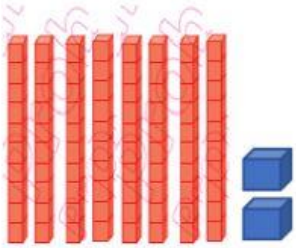

D	U
8	2

LIVEWORKSHEETS

TEMA: Números naturales hasta el 99

Actividades sincrónicas

Complete la secuencia **ascendente** y **descendente** de los siguientes números.

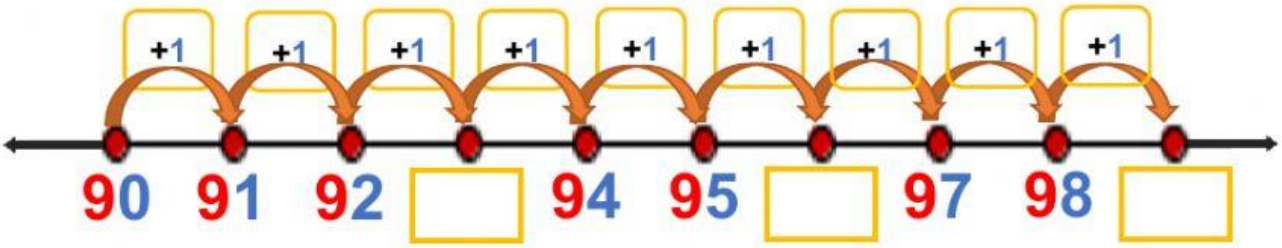

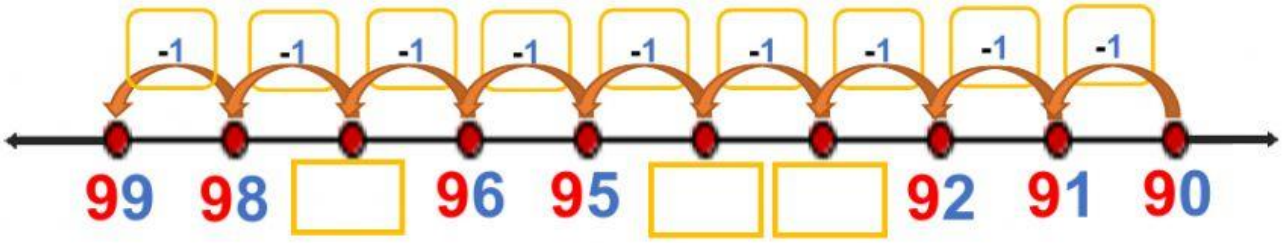

Complete la secuencia **ascendente** y **descendente** de los siguientes números.

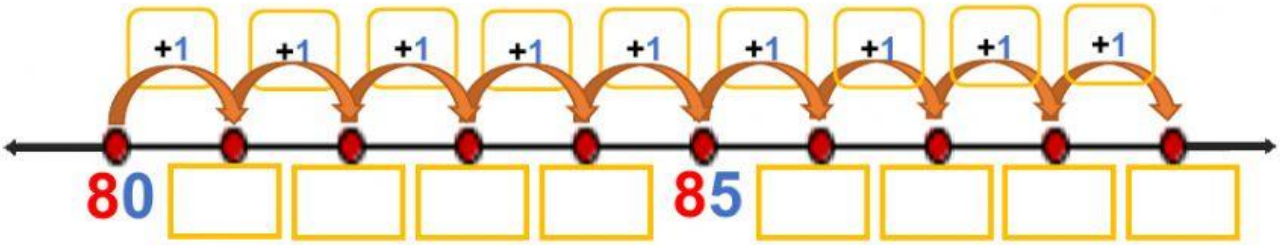

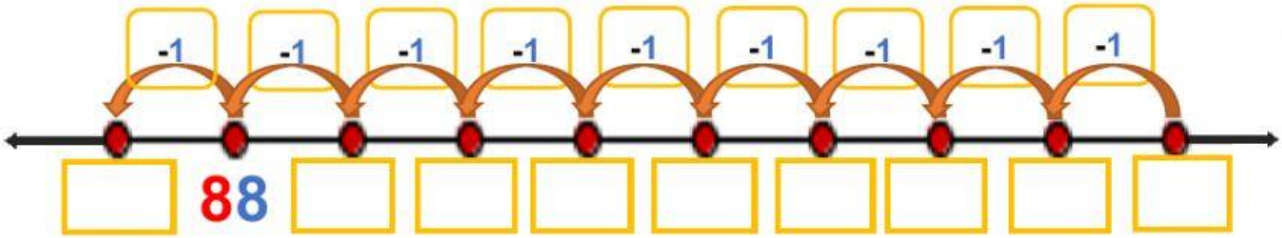

LIVEWORKSHEETS