Place Value - Hundreds, tens and units 1

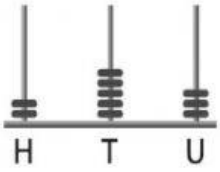

This abacus shows 2 hundreds, 5 tens and 3 units
This is 200 + 50 + 3
The number shown on the abacus is 253

Write the number shown on the abacus.

1.

_____

2.

_____

3.

_____

6.



_____

7.



_____

8.

_____

LIVEWORKSHEETS