PERIMETER QUIZ

Answer ALL questions correctly. Be sure to write the correct unit of measurement in your answers.

1. Calculate the perimeter of each shape below.

B)

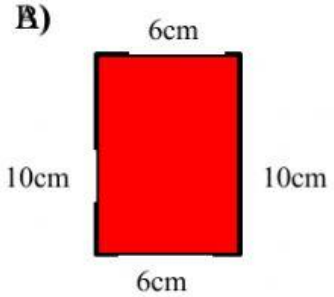

Perimeter _____

E)

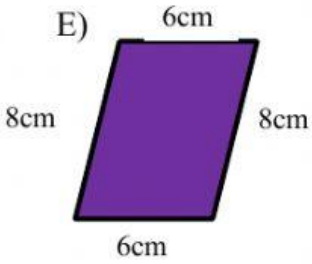

Perimeter _____

C)

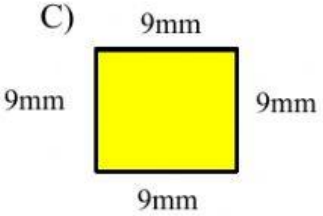

Perimeter _____

F)

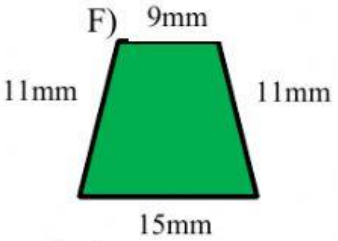

Perimeter _____

D)

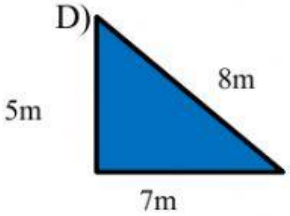

Perimeter _____

G)

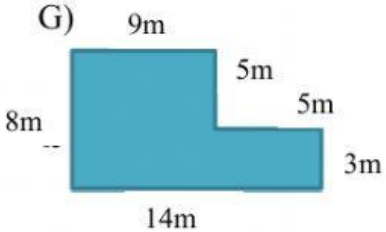

Perimeter _____

LIVEWORKSHEETS

H)



Perimeter _____

J)

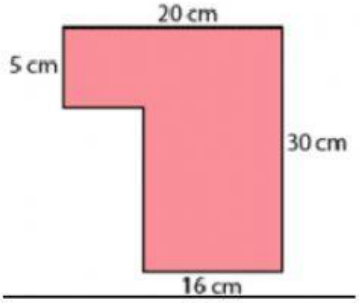

Perimeter _____

K)

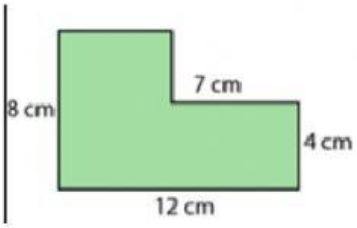

Perimeter _____

I)

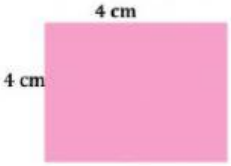

Perimeter _____

2. Use the perimeter of each shape below to find the length of the missing side(s).

a) _____

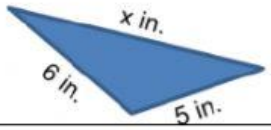

If perimeter = 19 in., x = _____

b)

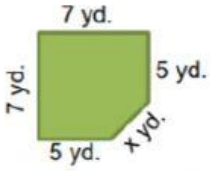

If perimeter = 27 yd., x = _____

LIVEWORKSHEETS

c)

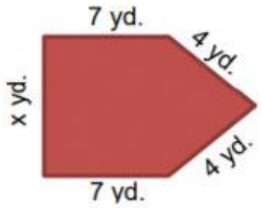

If perimeter = 28 yd., x = _____

d)

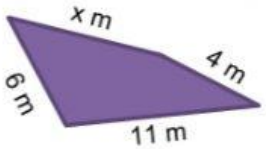

If perimeter = 28 m, x = _____

e)

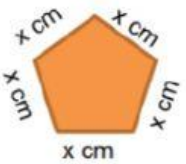

If perimeter = 45 cm, x = _____

f)

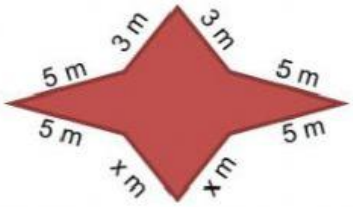

If perimeter = 34 m, x = _____

LIVEWORKSHEETS

g)

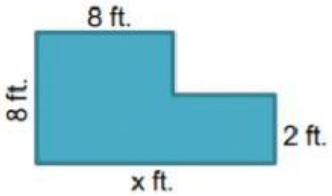

If perimeter = 40 ft., x = _____

h)

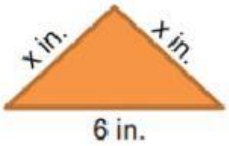

If perimeter = 16 in., x = _____

LIVEWORKSHEETS