Kendriya vidyalaya No. 1, Shahibaug, Ahmedabad.
Name: _____class:2. Subject: maths.

SOLID SHAPES.

Instructions: Drag each picture into under the correct solid shape.



LIVEWORKSHEETS

CUBE	CYLINDER	SPHERE	CONE	PYRAMID
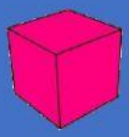	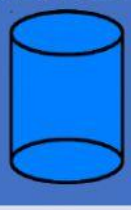			

LIVEWORKSHEETS
LIVEWORKSHEETS