E. M. PROFESSORA NEUZA MARIA DE ALMEIDA.

ALUNO:_____

2º ANO TURMA: _____ PROFESSOR(A):_____



DATA: _____/_____/2021

COMPONENTE CURRICULAR
MATEMÁTICA

RESOLVA AS CONTINHAS NA RETA NUMÉRICA:

9 + 3 = ☐

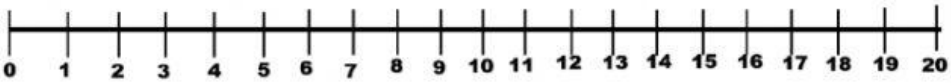

6 + 5 = ☐

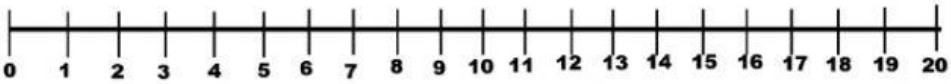

11 + 4 = ☐

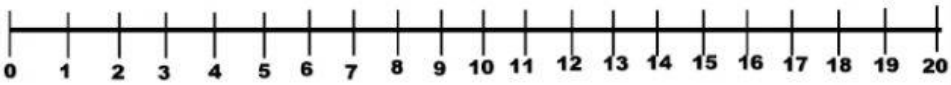

14 + 5 = ☐

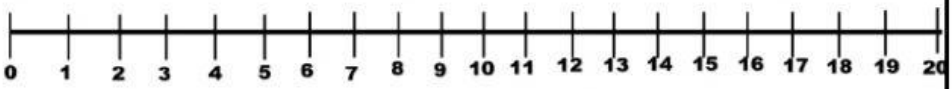

10 + 10 = ☐

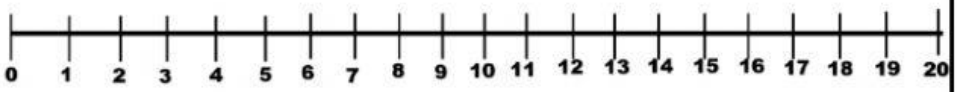

9 – 8 = ☐

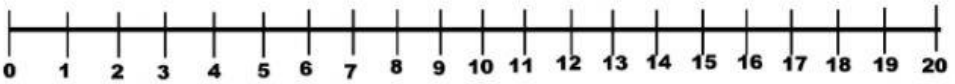

12 – 6 = ☐

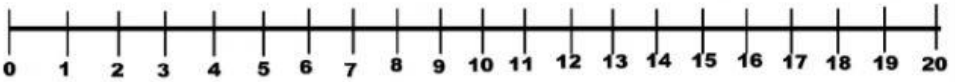

13 – 2 = ☐

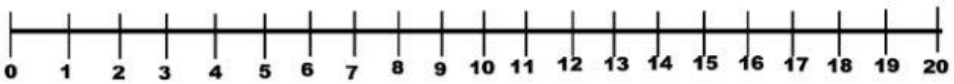

11 – 3 = ☐

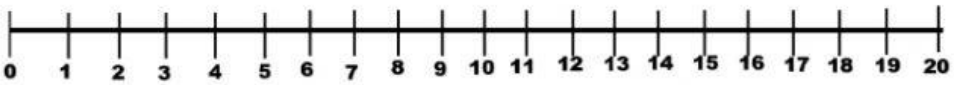

7 – 4 = ☐

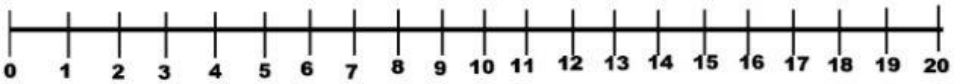

LIVEWORKSHEETS