Kubus dan Balok

Ayo hitunglah volume balok dengan kubus satuan.

1.

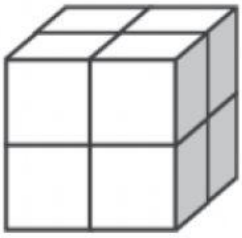

Volume = ... kubus satuan

2.

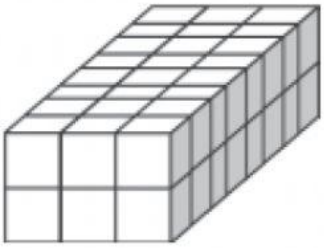

Volume = ... kubus satuan

3.

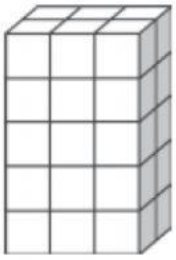

Volume = ... kubus satuan

4.

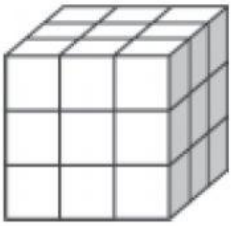

Volume = ... kubus satuan

5.

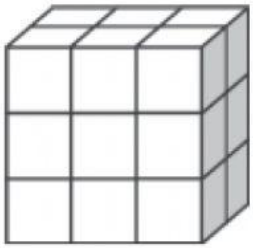

Volume = ... kubus satuan

6.

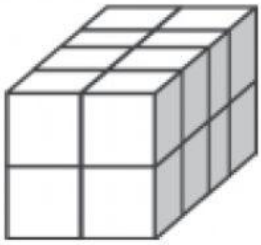

Volume = ... kubus satuan

7.

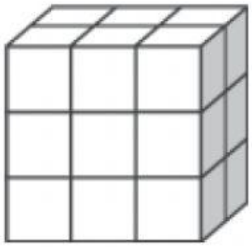

Volume = ... kubus satuan

8.

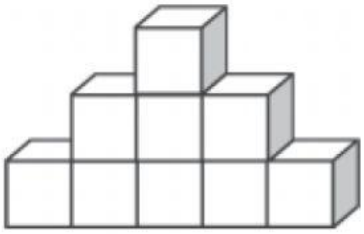

Volume = ... kubus satuan

9.

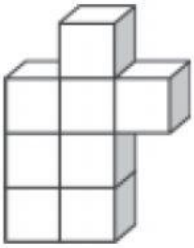

Volume = ... kubus satuan

10.

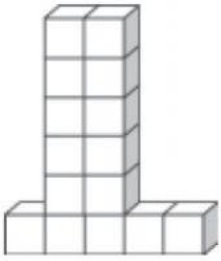

Volume = ... kubus satuan

Nama :

Sekolah :

LIVEWORKSHEETS