Valor posicional

100 CENTENA 10 DECENA 1 UNIDAD

Observa las fichas y escribe las cantidades que representan:

312

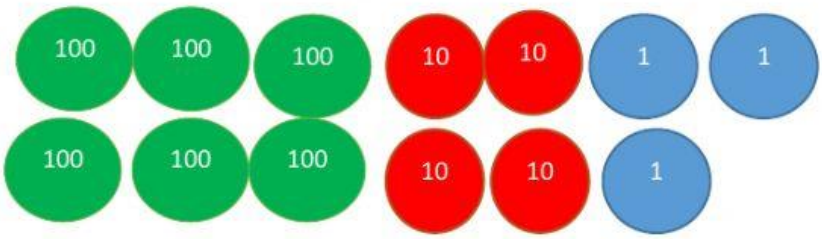

LIVEWORKSHEETS





LIVEWORKSHEETS