LECCIÓN DE MATEMÁTICAS 5TO DE BÁSICA

**1. Une** las semirrectas con el decimal correspondiente.

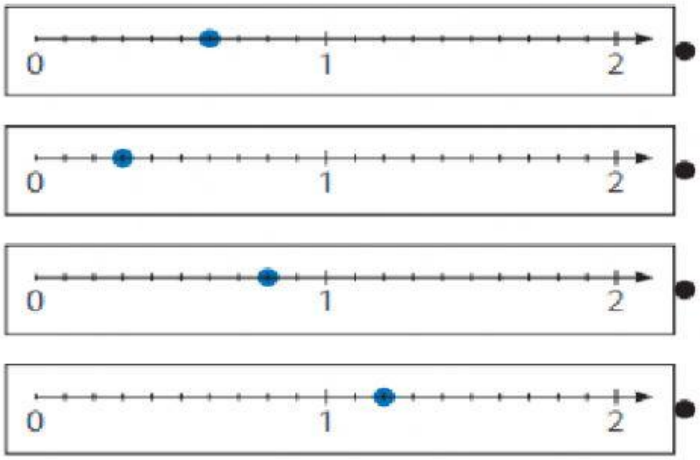


1,2

0,6

0,8

0,3

2. Encierra el número decimal que indica la semirrecta numérica y ordena de mayor a menor.

a. 1,2
b. 2,3
c. 2,4




a. 2,8
b. 3,4
c. 3,8

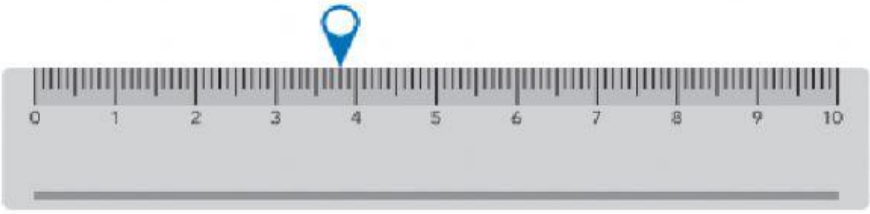


a. 1,7
b. 1,6
c. 1,8




_____ > _____> _____

3. Escoge el signo >, < o = según corresponda

56, 42 ◯ 56, 412 > < =

12,150 ◯ 12,15 > < =

10,9 ◯ 10,98 > < =

LIVEWORKSHEETS

LIVEWORKSHEETS