Atividade de matemática

Nome: _____

Turma: 9º ano

Data: 12/04 á 16/04/21

Professor: José Oreste

1-Faça os cálculos usando o teorema de Pitágoras, preenchendo de forma correta os espaços a seguir:

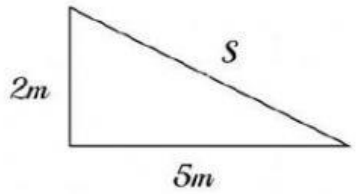

$a^2 = b^2 + c^2$

$\square^2 = \square^2 + \square^2$

$\square^2 = \square + \square$

$\square^2 = \square$

$\square = \sqrt{\square}$

$a = \square$ m

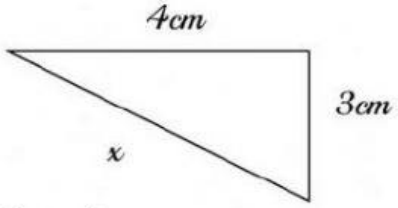

$a^2 = b^2 + c^2$

$\square^2 = \square^2 + \square^2$

$\square^2 = \square + \square$

$\square^2 = \square$

$\square = \sqrt{\square}$

$a = \square$ cm

2- Veja a medida do diâmetro de um pneu de automóvel. Sabendo que o diâmetro deste pneu mede 0,60 m , qual seria o valor aproximado da circunferência deste pneu ?

$C = 2.\pi.R$

$C = 2 . \square .R$

$C = \square . \square$

$C = \square$

LIVEWORKSHEETS

3-Determine o valor dos ângulos a seguir :

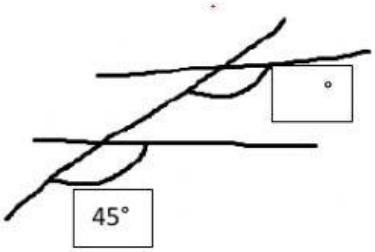

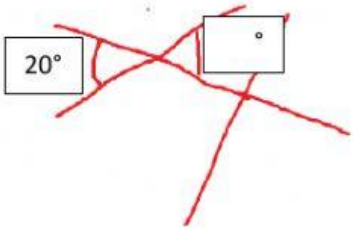

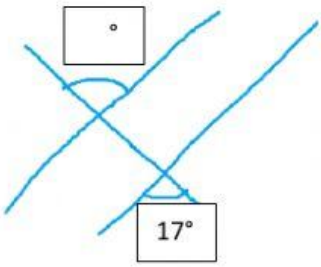

4 Classifique os ângulos abaixo:

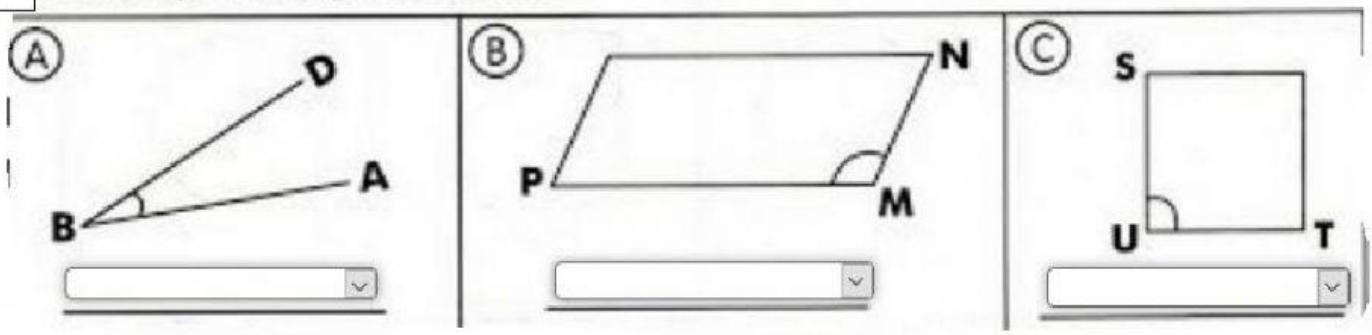

LIVEWORKSHEETS