Guía de Trabajo

I. En cada conjunto los grupos de 10 y los elementos sueltos. Luego completa los recuadros.

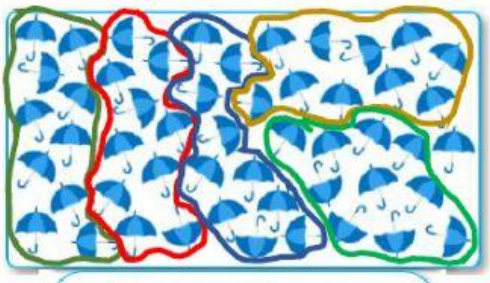

D + U

+ =

D + U

+ =

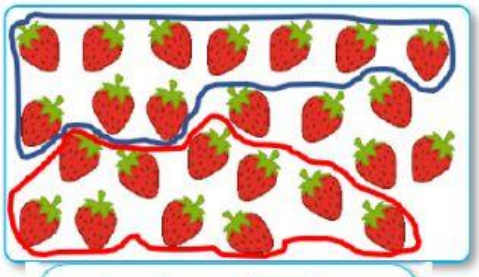

D + U

+ =

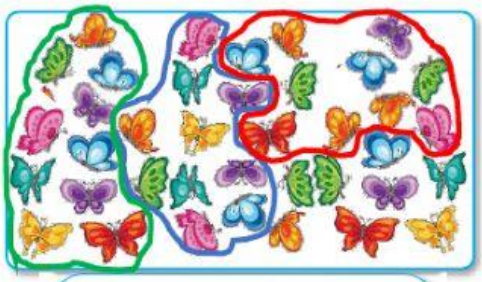

D + U

+ =

II. Une las descomposiciones con la adición correcta.

5D y 9U	50 + 9 = 59
7D y 2U	20 + 7 = 27
1D y 0U	70 + 2 = 72
2D y 7U	10 + 0 = 10

LIVEWORKSHEETS

III. Selecciona el número correcto de unidades y decenas y luego completa la descomposición.

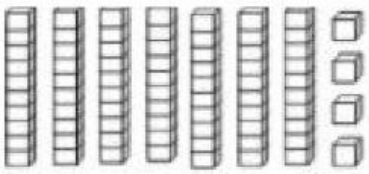

DECENAS	UNIDADES

☐ + ☐ = ☐

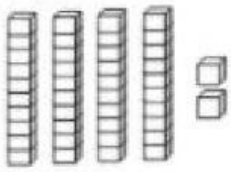

DECENAS	UNIDADES

☐ + ☐ = ☐



DECENAS	UNIDADES

☐ + ☐ = ☐

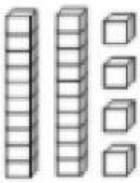

DECENAS	UNIDADES

☐ + ☐ = ☐

DECENAS	UNIDADES

☐ + ☐ = ☐

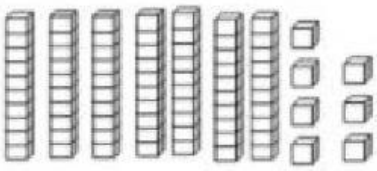

DECENAS	UNIDADES

☐ + ☐ = ☐

LIVEWORKSHEETS