Re-connect

Look at the map of Manhattan and read the quick facts then do the exercises.

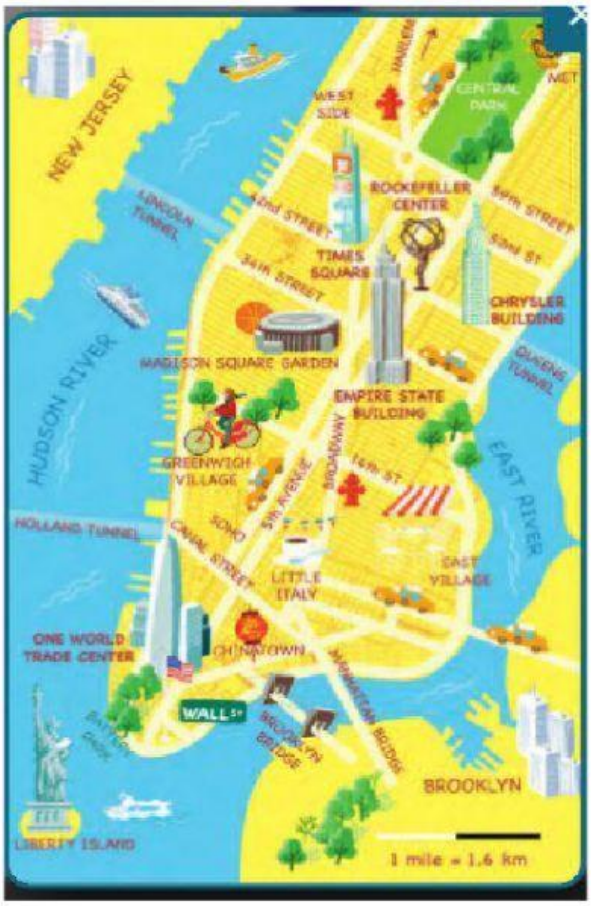

NYC Quick Facts

- New York City is located in the **north** of the USA, on the **east** coast. It is situated in the state of New York.
- There are 8.5 million **inhabitants** in NYC.

- New York City is divided into five **boroughs**:
  - Manhattan
  - Brooklyn
  - the Bronx
  - Queens
  - Staten Island.

- 200 languages
- 237 skyscrapers
- 5,000 street food vendors
- 468 subway stations
- 13,000 cabs
- currency = dollar

- Manhattan forms a grid of 228 **streets** and 12 **avenues**. 2 avenues and 2 streets form a rectangle called a **block**.

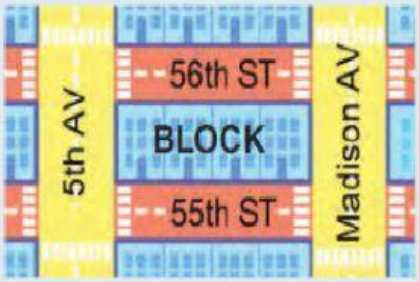

NYC stands for :

N..... Y..... C.....

What's the nickname of the city? .....

LIVEWORKSHEETS

1. Spot New-York on the map

2. Read the text, label the 5 boroughs according to the directions (North / East / West / South)

Manhattan is in the centre, between the **East River** and the **Hudson River**. Brooklyn is in the southeast, **the Bronx** in the north, **Queens** in the east and **Staten Island** in the southwest.

Help!

100 = one hundred
1,000 = one thousand

The Empire State Building is one thousand four hundred and fifty-four feet tall (1,454 ft).

LIVEWORKSHEETS

3. Read the quick facts and write the numbers, then match them with the correct information.

two hundred and twenty-eight:	number of boroughs
five:	number of cabs
twelve	number of languages
eight point five:	number of streets
thirteen thousand:	number of avenues
two hundred:	million inhabitants

4. Use the map and name the buildings



....

1,776 ft 1,454 ft 1,046 ft

5. Now write the numbers and find out the corresponding buildings.

1,776 : .....is .....
..... feet tall.

1,454 : The ..... is .....
..... feet tall.

1,046 : The ..... is .....
..... feet tall.

LIVEWORKSHEETS