ICHTHUS SCHOOL

Name: _____ Grade: 2 _____ Date: _____

Subject: Mathematics Topic: Fractions

Write the fraction for each shape.

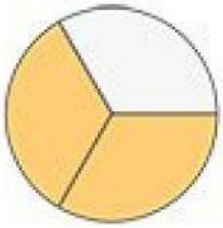 $\frac{2}{3}$	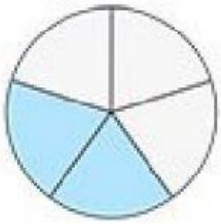 ___	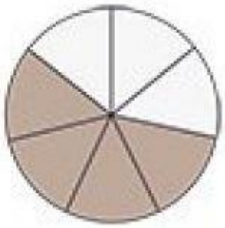 ___
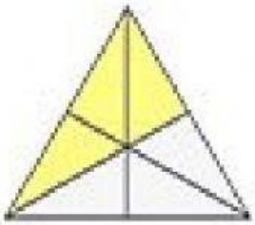 ___	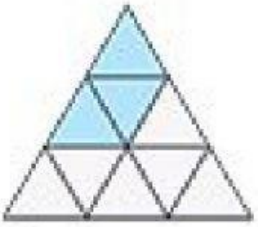 ___	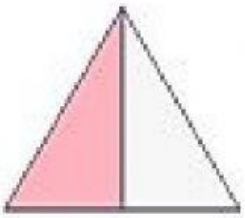 ___
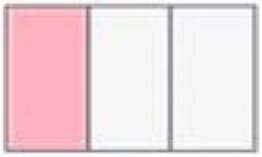 ___	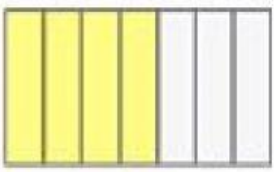 ___	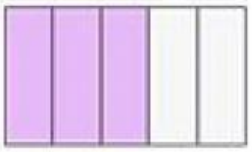 ___
 ___	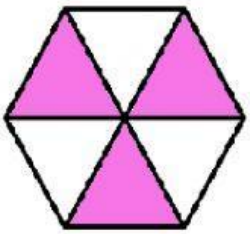 ___	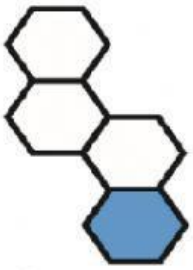 ___

LIVEWORKSHEETS