Lembar Kerja Peserta Didik

Nama : _____ **Kelas** : **2 C**

Pecahan adalah bagian dari keseluruhan bagian

Gambar berikut menunjukan 3 bagian Pizza dari keseluruhan 4 bagian. Maka dapat di tulis 3/4

Tarik pecahan di bawah ini ke pizza di samping kiri sesuai dengan gambar!

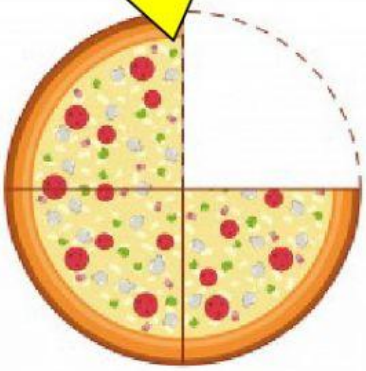

$\frac{3}{4}$

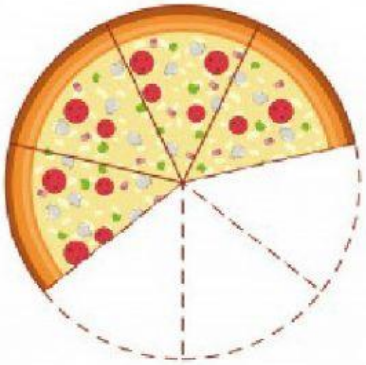

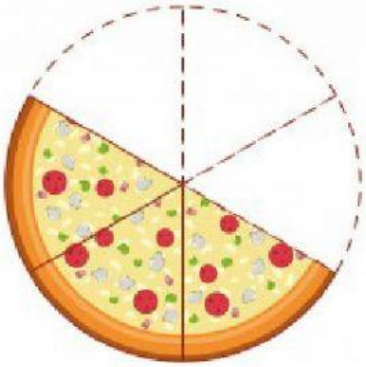

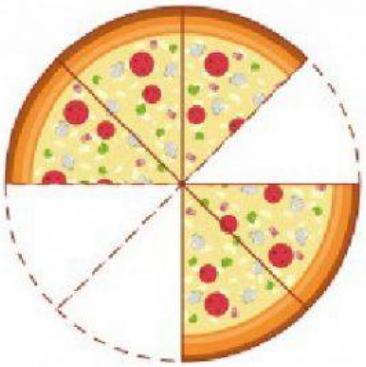

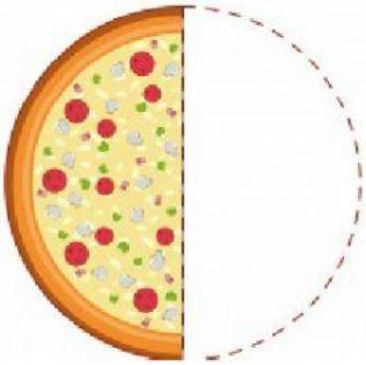

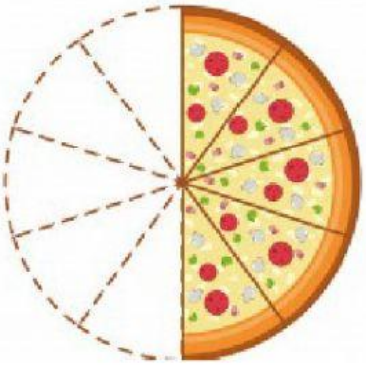

$\frac{3}{6}$

$\frac{1}{2}$

$\frac{4}{7}$

$\frac{5}{8}$

$\frac{5}{10}$

LIVEWORKSHEETS