Escuela Los Rastrojos
Matemática 3° Básico
Profesor: José Silva Pinto

Une, con una línea, la figura de la columna A con el número de la columna B, según corresponda.

A

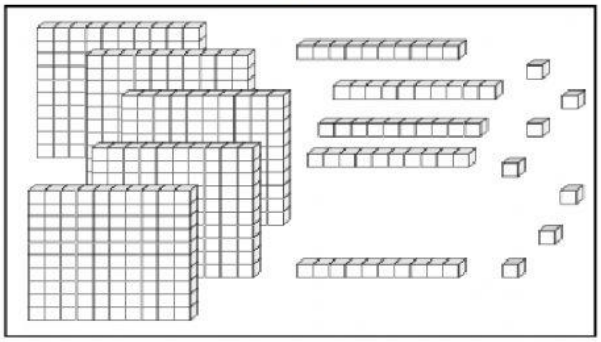

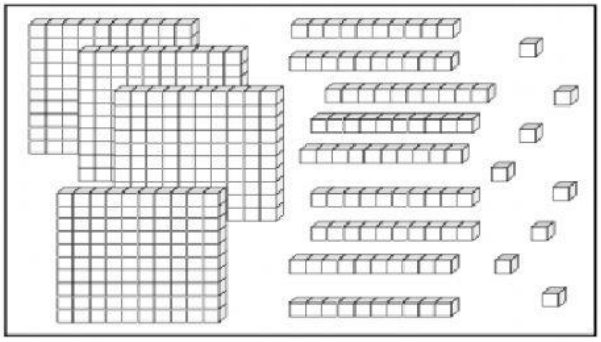

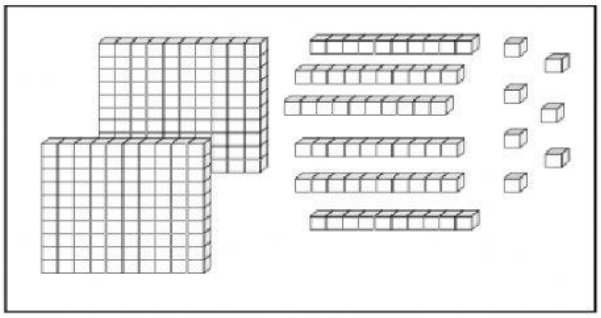

B

575

200 + 60 + 7

500 + 50 + 7

276

498

Escribe en la tabla la cantidad de cubos que necesites para:

Número a formar			
978			
347			
165			
254			
374			

LIVEWORKSHEETS