ΤΣΑΡΟΥΧΙΑ & ΜΟΤΙΒΑ

Παρατήρησε το μοτίβο που επαναλαμβάνεται σε κάθε τσαρούχι και ένωσέ το με το αντίστοιχο μοτίβο σχημάτων

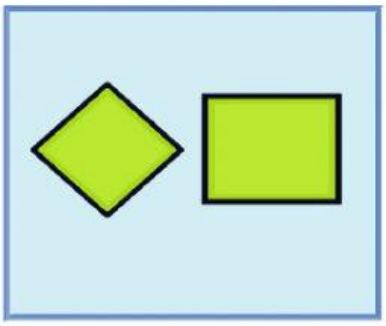



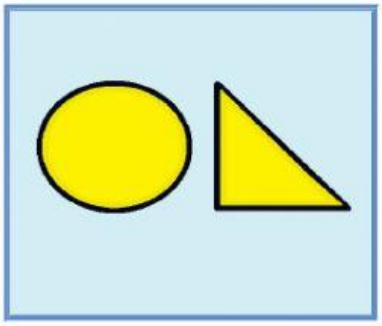



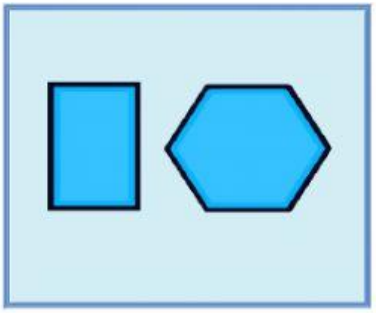





Α.Γ. 29/03/2021

LIVEWORKSHEETS