QUADRILATERALS

HOMEWORK
3/29/2021

DIRECTIONS: Select the correct answer.

1. A polygon is a closed plane figure composed of at least three segments that do not cross.

a. true	**b. false**

2. A quadrilateral is a four or more-sided polygon.

a. true	**b. false**

3. Which of these figures are quadrilaterals?

4. Which of the following figures is a rhombus?

a. 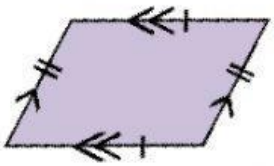	**b.** 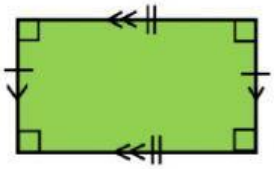
c. 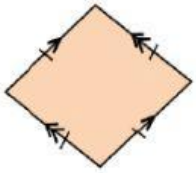	**d.** 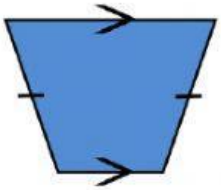

LIVEWORKSHEETS

5. Which of the following figures is a trapezoid?

a. 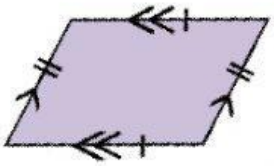	b. 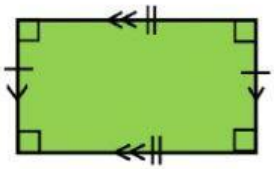
c. 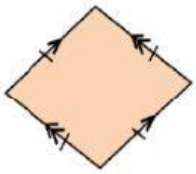	d. 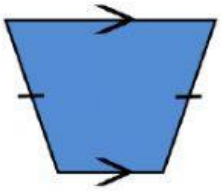

6. Which of the following figures is a parallelogram?

a. 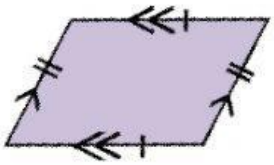	b. 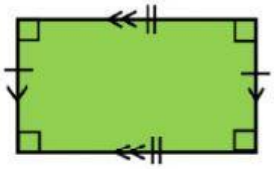
c. 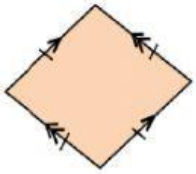	d. 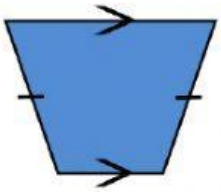

7. Which of the following figures is a rectangle?

a. 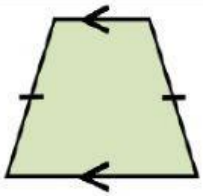	b. 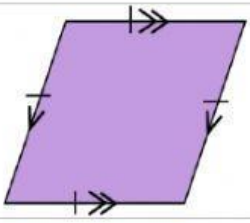
c. 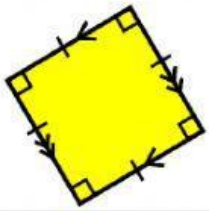	d. 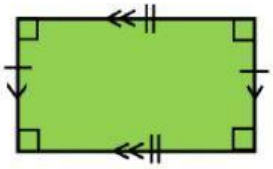

LIVEWORKSHEETS

8. Which of the following figures is a square?

a. 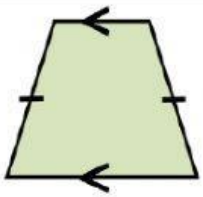	**b.** 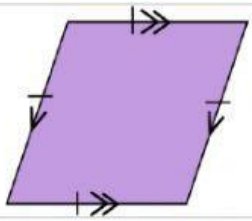
c. 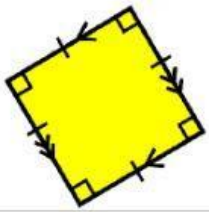	**d.** 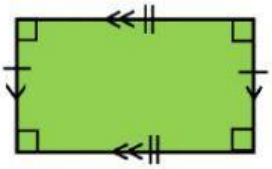

LIVEWORKSHEETS