Name: _____ Date: _____

# Multiplication Strategies

## (equal groups, repeated addition, arrays)

**Find the product of the following multiplication sentences.**

1. 6x7=_____
2. 5x4=_____
3. 8x2=_____
4. 6x3=_____
5. 3x9=_____
6. 4x5=_____
7. 7x2=_____
8. 1x9=_____
9. 10x3=_____
10. 5x2=_____
11. 4x11=_____
12. 12x2=_____

**Write the multiplication sentence for each.**



___ x ___ = ___

7+7+7+7

=___

___ x ___ = ___



___ x ___ = ___

___ x ___ = ___

4+4+4+4+4

+4+4=___

___ x ___ = ___

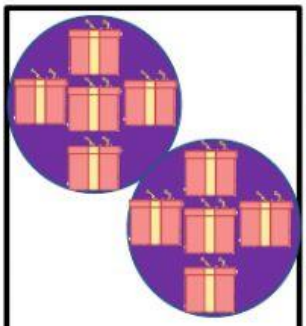

___ x ___ = ___

___ x ___ = ___



___ x ___ = ___

LIVEWORKSHEETS