Запиши зображені числа у вигляді неправильного дробу та мішаного числа

1) 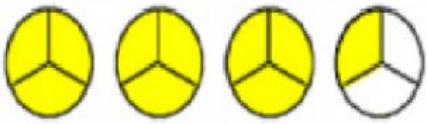	$\frac{10}{3}$	$3\frac{1}{3}$
2) 	___	___
3) 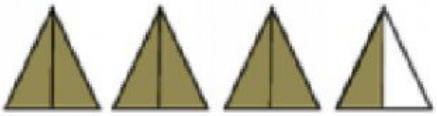	___	___
4) 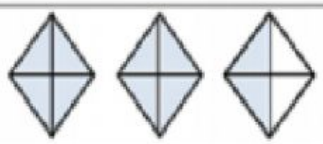	___	___
5) 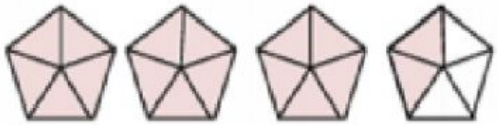	___	___
6) 	___	___
7) 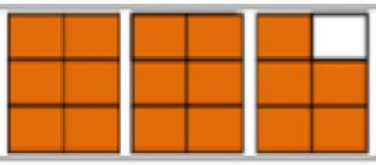	___	___
8)	___	___
9) 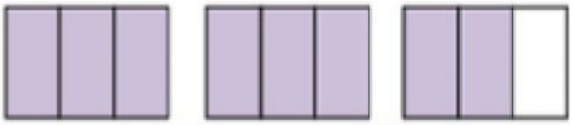	___	___
10) 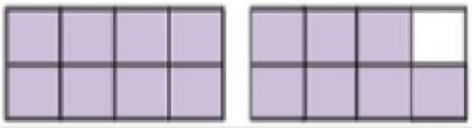	___	___

LIVEWORKSHEETS