C.F: PENSAMIENTO MATEMÁTICO. (MATEMÁTICAS)

-Selecciona la opción que represente el número de hamburguesas que se va a comer el dragón.

¿CUANTAS HAMBURGUESAS SE VA A COMER EL DRAGÓN?

5 3 8 2 4



8 5 6 9 1



3 8 10 2 7



8 4 10 6 1



5 8 4 7 3



5 3 10 2 8

Mtra.: Lilian Adelina Abrica Vences.

LIVEWORKSHEETS