1. Find the total:

14	22	75	34	42
+ 52	+ 45	+ 23	+ 25	+ 32
____	____	____	____	____

2. Find the total:

27	45	58	96	56
- 12	- 20	- 22	- 54	- 13
____	____	____	____	____

3. Write two equations for the arrays (addition and multiplication):

		
5 x 2 = 10 5 + 5 = 10	___ x ___ = ___ ___ + ___ + ___ = ___	___ x ___ = ___ ___ + ___ + ___ = ___

LIVEWORKSHEETS

		
____ x ____ =____ ___ + ___ + ___ + ___ =___	____ x ____ =____ ____ + ____ =____	____ x ____ =____ ____ + ____ =____

4. Find the total:

a. 1 x 2 = _____	b. 10 x 5 = _____	c. 10 x 3 = _____
d. 4 x 2 = _____	e. 3 x 5 = _____	f. 10 x 8 = _____
g. 9 x 5 = _____	h. 7 x 2 = _____	i. 5 x 5 = _____
j. 6 x 10 + _____	k. 11 x 10 = ____	l. 8 x 2 = _____

LIVEWORKSHEETS

5. Use the array to find the total:

 $8 \div 2 = 4$	 $4 \div 2 =$ ____	 $10 \div 2 =$ ____
 $10 \div 5 =$____	 $15 \div 5 =$____	 $20 \div 2 =$____

LIVEWORKSHEETS