LKPD

(Lembar Kerja Peserta Didik)

Nama : _____ **Kelas** : 4 ___

Ayo Membilang

15 Menit

Isilah titik-titik berikut sesuai dengan luas bangun!



(1)

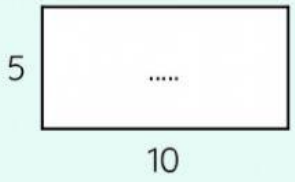

(2)

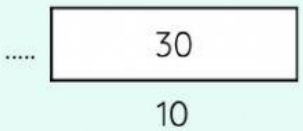

(3)

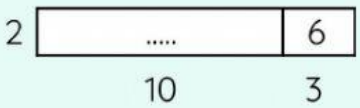

(4)

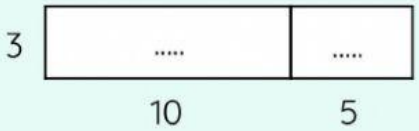

(5)

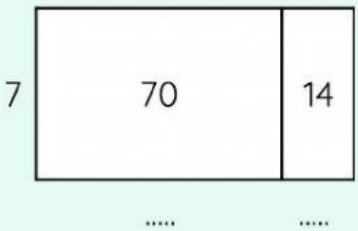

(6)

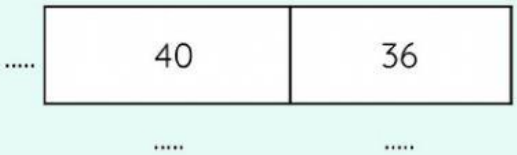

(7)

LIVEWORKSHEETS