

REPASO FIGURAS GEOMÉTRICAS

① Cuenta las figuras que hay de cada tipo en el dibujo y completa la tabla.

triángulos	
rectángulos	
círculos	
cuadrados	
estrellas	
óvalos	

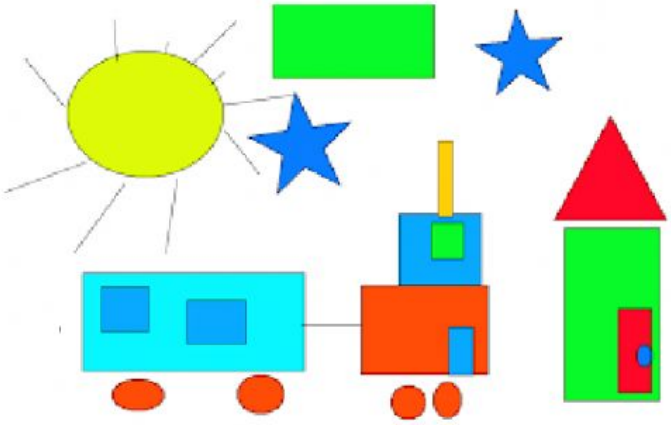

② ¿Es un círculo o una circunferencia? Une.



CIRCULO

CIRCUNFERENCIA

③Cuenta y completa.

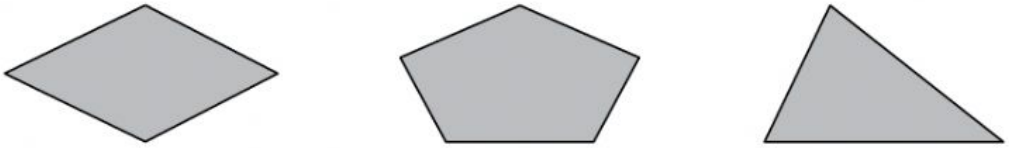

LIVEWORKSHEETS

☐ lados	☐ lados	☐ lados
☐ vértices	☐ vértices	☐ vértices

④Une con flechas:

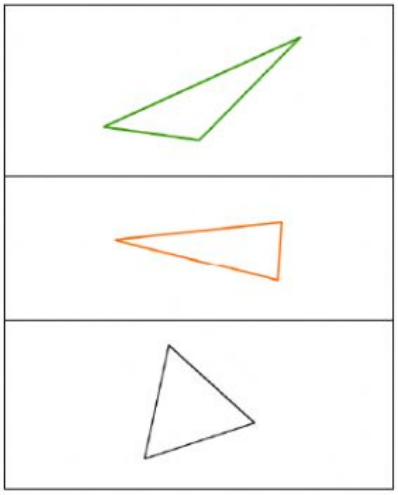

ISÓSCELES

ESCALENO

EQUILÁTERO

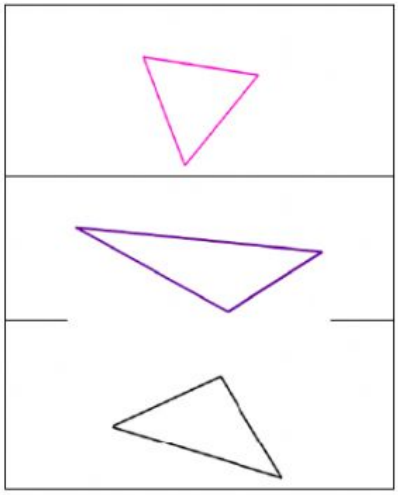

⑤Une cada tipo de línea con su nombre:



Recta	**Curva**	**Poligonal abierta**	**Poligonal cerrada**	**Diagonal**	**Espiral**

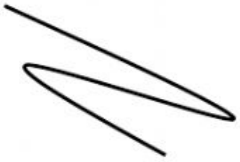

LIVEWORKSHEETS