A Name the components found in the electrical circuit below.

SP 7.1.1

Dry cell | Bulb | Switch | Connecting wire

1.

2.

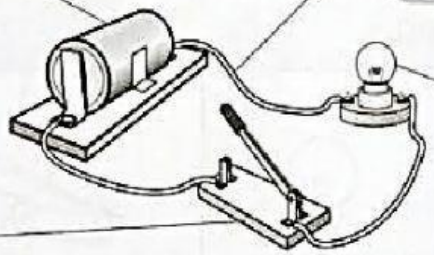

4.

3.

B Match the electrical component to its function.



Complete and break an electric circuit.

Supply electrical energy

Produce light

Connect each electrical component into a complete circuit



LIVEWORKSHEETS