| ICM INSAN CENDEKIA MADANI | Chapter 9 (Multiplication and Division) | Name : | | | |
|---|---|---|---|---|---|
| | | Grade : | IV (Four) | | |
| | | Subject : | Mathematics | | |
| | | Date : | | | |
| **Sequence of Teaching** | | Marks | Score | Teacher Signature | Parent Signature |
| ☐ Independent Practice<br>✓ Assessment | | | | | |

## Answer the questions carefully!

1. Choose a colour and colour each chicken differently.

   Multiply the number in each chicken by 10 or 100.

   Then, colour the eggs with the correct answers matching the colour of the chicken.




[2]

2. Complete the table

| | Multiply by 10 | Multiply by 100 |
|---|---|---|
| 27 | 270 | |
| 843 | | 84 300 |
| 560 | | |

[2]

LIVEWORKSHEETS

3. K Match the numbers that multiply to the answers.

An example has been done for you.

| | | |
|---|---|---|
| 5 | 8 | 45 |
| 6 | 7 | 49 |
| 7 | 6 | 48 |
| 8 | 5 | 32 |
| 9 | 4 | 30 |

[2]

4. A storekeeper bought 45 cartons of canned drinks. Each carton has 100 cans.

He repacked the cans into packs of 10. How many packs are there?

_____

[1]

5. Find the answer using the appropriate multiplication facts given.

| | |
|---|---|
| 13 × 6 = 78 | 2 × 15 = 30 |

a. 26 x 6 = _____

b. 8 x 15 = _____

c. 6 x 15 = _____

d. 130 x 6 = _____

[2]

6. A movie ticket cost $8.

A total of $96 was collected from the sale of the tickets for the movie.

How many people watched the movie?

_____

[1]

LIVEWORKSHEETS

7. Use the clues to complete the cross-number puzzle.

**Cross**

(C) 2640 ÷ 20

(E) 700 ÷ 100

**Down**

(A) 910 ÷ 10

(B) 7200 ÷ 600

(D) 7400 ÷ 200

**Diagonal**

(F) 2600 ÷ 100

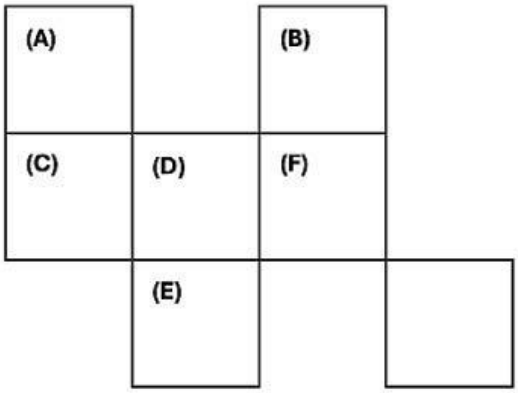


[2]

8. 79 pencils are divided into 6 stands equally.

How many pencils are there in each stand?

How many pencils are left?

_____

_____

[2]

9. Divide the number in each rabbit by 10 or 100.

Then, join each rabbit to the carrots containing the correct answers using a line.

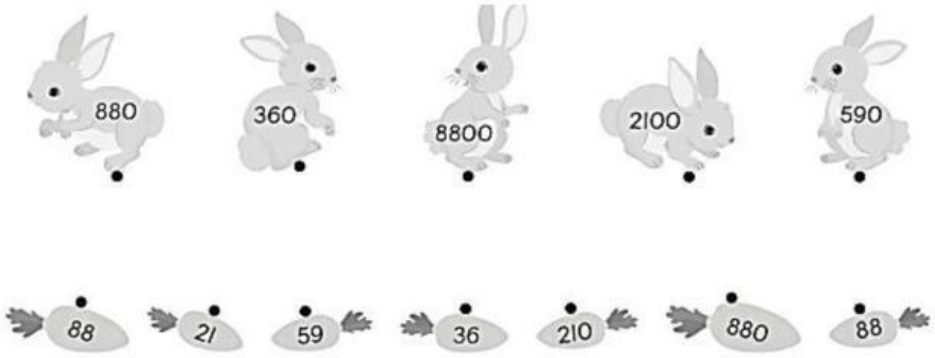


[2]

LIVEWORKSHEETS

10. There are 87 rulers.

7 rulers are packed into each bag.

How many bags of rulers are there?

How many rulers are left?

_____

_____

[2]

11. Connect the expressions with the same answer.

| | |
|---|---|
| $7 \times 4 \times 5$ • | • $8 \times 18$ |
| $8 \times 3 \times 6$ • | • $7 \times 20$ |
| $9 \times 5 \times 8$ • | • $9 \times 40$ |

[2]

12. Safia puts 62 photos in photo frames.

Each photo frame holds 8 photos.

Write the number of photo frames she could completely fill.

_____photo frames [1]

| Teacher Feedback | Parent Comment |
|---|---|
| | |

LIVEWORKSHEETS