3 分数

活动 1 3.1.1

① 哪个被切成一半？在 里画 ✓。 TP1

a



b



c



d

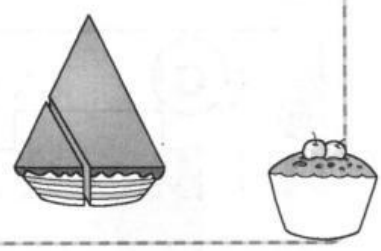

② 谁拿了二分之一个派？圈出答案。 TP4

a b c



LIVEWORKSHEETS

LIVEWORKSHEETS

复习

1 用文字写出下列涂黑部分的分数。

a

b

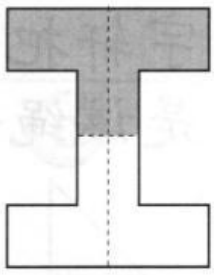

c

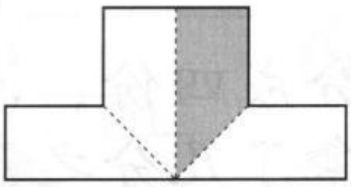

d

e

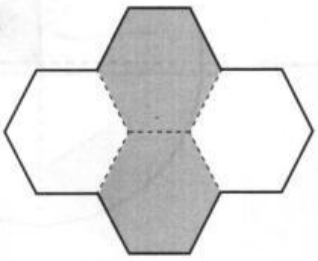

f