PERBANDINGAN BILANGAN DAN PENERAPANNYA

Tulis bilangan dan bandingkan angka di bawah ini dengan tanda “<”, “>”, “=”.

Nama Siswa: _____ Kelas: 1C



2 > 1





Guru Kelas 1 C:

Yenni, S.Pd

LIVEWORKSHEETS