ชื่อ-สกุล.....ชั้น ม.....เลขที่.. .....

ใบงานที่ 2 เรื่อง รูปเรขาคณิตสามมิติที่ประกอบขึ้นจากลูกบาศก์

คำชี้แจง : จงเขียนตัวเลขแสดงจำนวนลูกบาศก์จากภาพด้านหน้า ภาพด้านข้าง และภาพด้านบนของรูปเรขาคณิตสามมิติในแต่ละข้อต่อไปนี้

ข้อ	รูป 3 มิติ	ภาพด้านหน้า	ภาพด้านข้าง	ภาพด้านบน
1	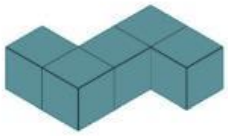			
2				
3		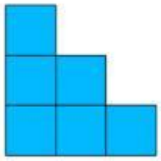		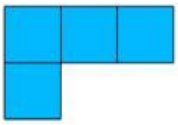
4				
5				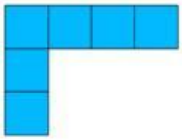

LIVEWORKSHEETS