Class 3

Mathematics (Math Mela) Worksheet

Chapter 4- Vacations with My Nani Maa

Que1.a. Addition means _____ numbers together. (adding/subtracting) **CG 1.3**

b. Subtraction means _____ one number from another. (adding/taking away)

Que2. a. In addition, the answer is always bigger than the numbers we add. (True/False) **CG 1.3**

b. In subtraction, we always get a smaller number as the answer. (True/False)

Que3. Match the following: CG 1.3

a) 6 + 3	i) 8
b) 9 - 3	ii) 9
c) 7 + 3	iii) 6
d) 10 - 2	iv) 10

Que4. How many more to make 10 in each tens frame? CG 1.1





LIVEWORKSHEETS

Que5. Complete the following number sentences: CG 1.3

a. 35 + ____ = 40

b. 20 - ____ = 10

c. ____ + 15 = 20

Que6. Solve using Number Line- CG 1.1

5 + 3 6+ 4 10 - 6 7 - 2

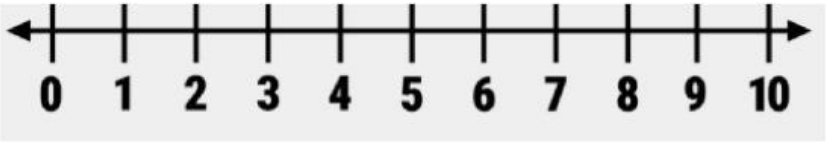

Que 7. Fill in the missing numbers in this magic square so that each row, column, and diagonal add up to 15: CG 4.1

4	9	
3		7
1		

Que 8. Look at the number line. If the frog jumps 10 steps forward, where will it land? CG 1.1

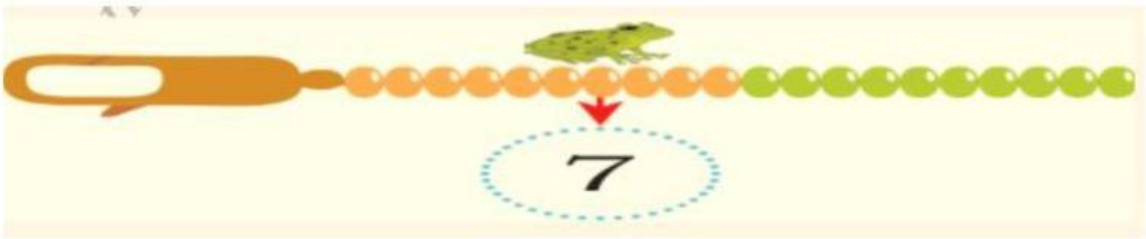

Que 9. Solve the given puzzle. CG 4.1

	3		12
	5		15
	7	4	18
7	15	23	

LIVEWORKSHEETS

Que 10. Fill in the tables by jumping as instructed. CG 4.1

Jump 9

29	12	93
38		84
	39	

Que 11. Look at the picture.How many ants there are under the leaves?

CG 4.1

LIVEWORKSHEETS