MAKING OBSERVATIONS AND INFERENCES

Diagrams	Observation	Inference
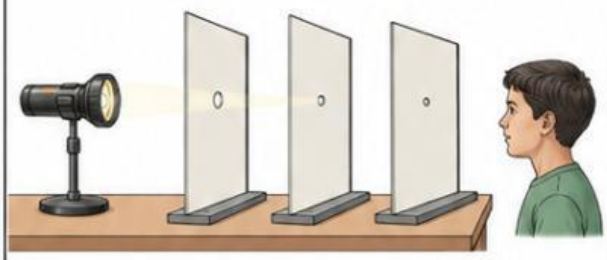		
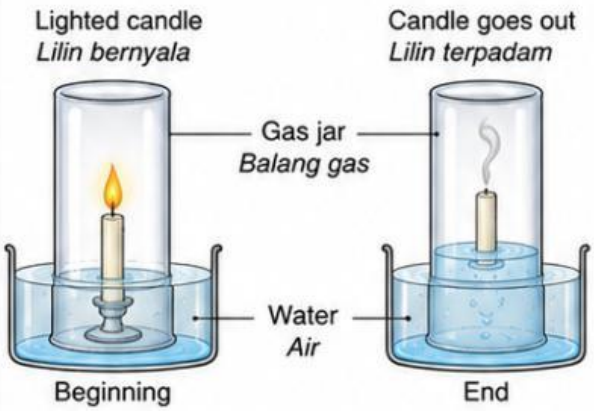		

LIVEWORKSHEETS

Diagrams	Observation	Inference
 Candle Y is extinguished faster than candle X. Give an inference for this experiment.		
Diagram P shows two roof colours, P and Q, with other walls of different colours. *Rajah P menunjukkan dua buah bumbung, P dan Q, dengan dinding berwarna yang berlainan warna.* 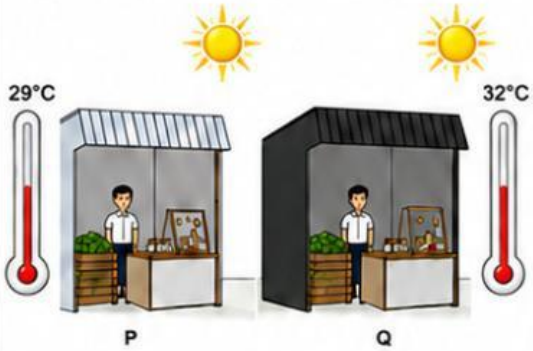		
1. 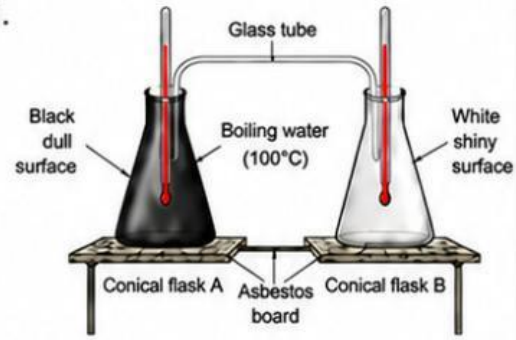 After 30 minutes, the temperature in conical flask B is higher than the temperature in conical flask A. Give an inference for the situation in conical flask B.		
2.  Give an inference for torch light W.		
3. 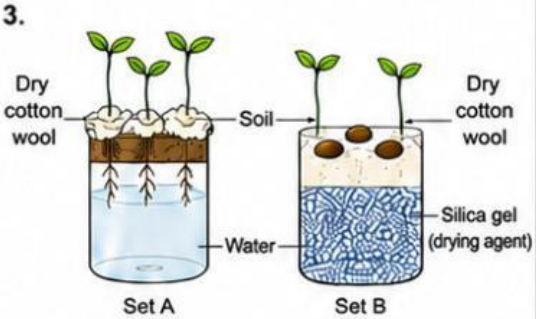 What is the inference for this experiment?		

LIVEWORKSHEETS