MATHEMATICS EXERCISE: AREA

Name: _____ Date: _____

- Area of a rectangle = length × width
- Total area = Area of shape 1 + Area of shape 2
- Answer unit: cm^2

Find the area of each given shape. Show the calculation and write the answer in cm^2.

1

Find the area of the given shape.

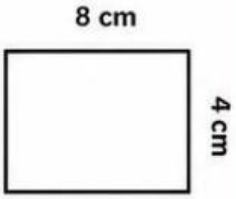

Answer: _____

2

Find the area of the given shape.

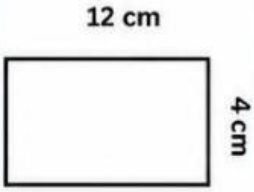

Answer: _____

3

Find the area of the given shape.

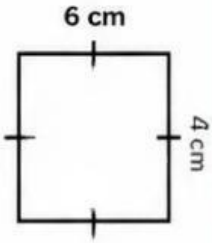

Answer: _____

4

Find the area of the given shape.

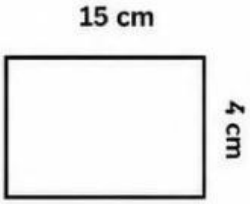

Answer: _____

5

Find the area of the given shape.

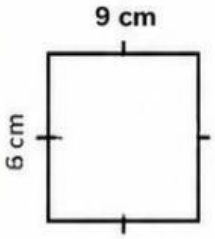

Answer: _____

6

Find the area of the given shape.

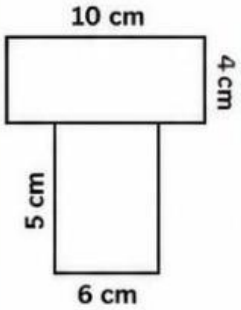

Answer: _____

7

Find the area of the given shape.

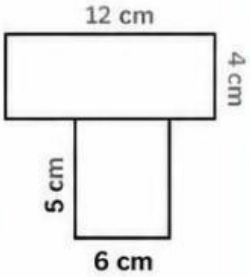

Answer: _____

8

Find the area of the given shape.

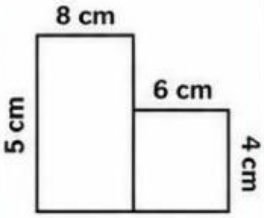

Answer: _____

9

Find the area of the given shape.

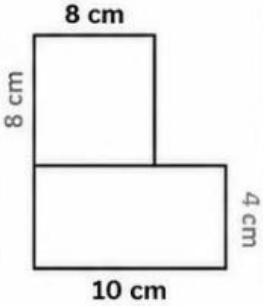

Answer: _____

10

Find the area of the given shape.

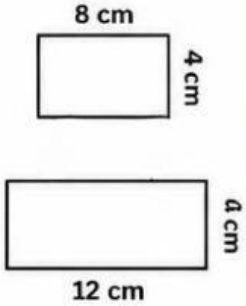

Answer: _____

Effort + Focus = Success!

LIVEWORKSHEETS