Jawab **semua** *soalan.*

1 Jawab setiap soalan di bawah berdasarkan arahan yang diberikan. BT: m.s. 24 | TP1 | Aras: R

OMG m.s. 29 DSKP (A)

(a) Padankan industri yang menggunakan robot dengan rajah yang betul.

A Industri Pertanian

B Industri Pembuatan

C Industri Elektronik

D Industri Automotif

E Industri Makanan



(i)



(ii)

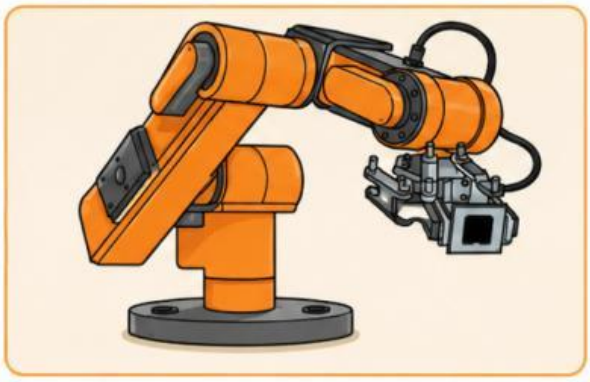

(iii)

(iv)

LIVEWORKSHEETS