NAME: _____NO. ___ M.4/__

UNIT 2: READING GRAPH AND CHART

A bar chart compares annual smartphone sales (in millions of units) across three brands:

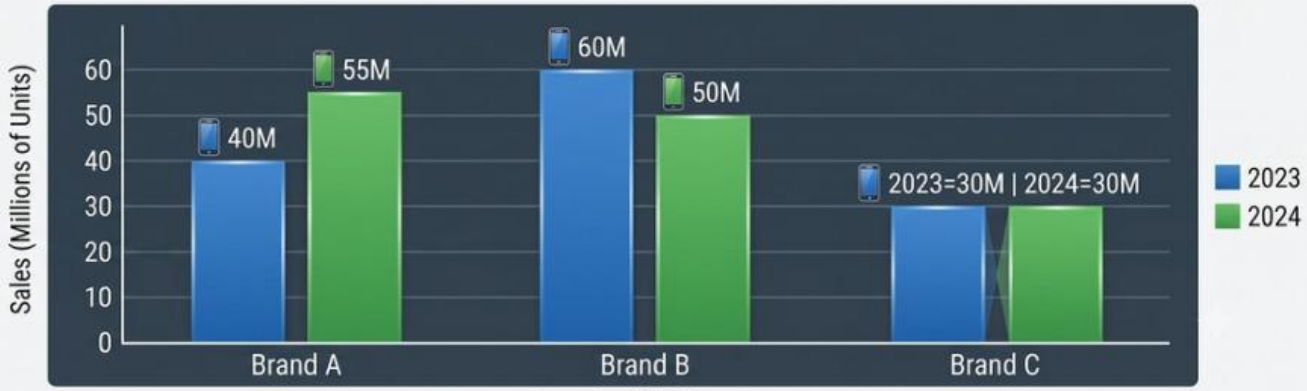

Source: Annual Sales Reports

1. Which brand experienced growth in sales from 2023 to 2024?

---

2. What was the sales trend for Brand C between 2023 and 2024?

---

3. In 2023, which brand had the highest market performance?

---

4. What were the total smartphone sales for all three brands combined in 2024?

A bar chart displays the weekly reading habits of high school students (in hours per week):

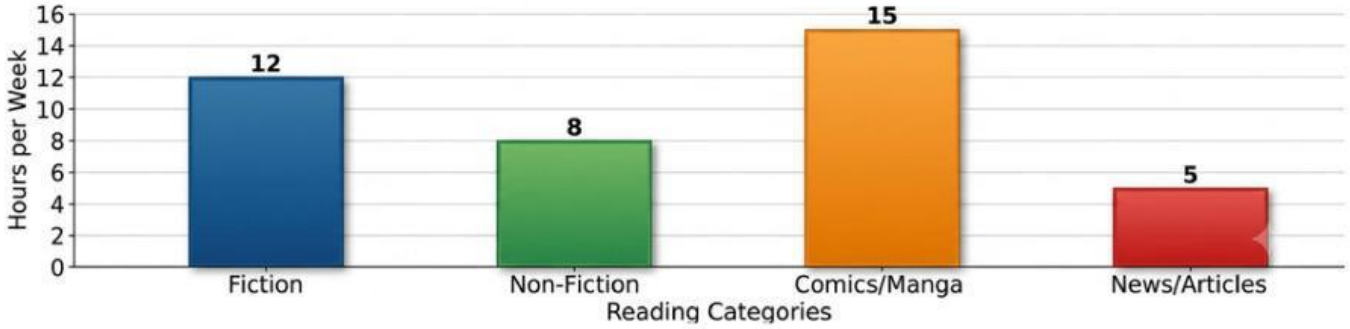

1. Which genre is the most popular among the students?

---

2. How many hours do students spend reading Fiction and Non-Fiction combined?

---

3. What is the difference in hours between the highest and lowest read categories?

---

4. "Total weekly reading time is less than 30 hours." (True or False)

LIVEWORKSHEETS

NAME: _____NO. ___ M.4/__

UNIT 2: READING GRAPH AND CHART

1. What caused the sharp spike in visitors in Week 3?

---

2. Between Week 3 and Week 4, traffic _____.

---

3. What was the total increase in visitors from Week 1 to Week 3?

---

4. Which overall statement best summarizes the 5-week trend?

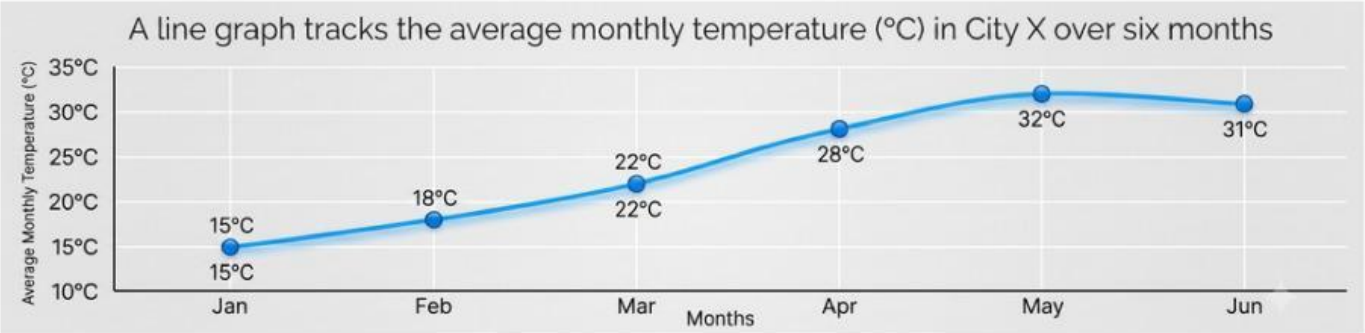

1. During which period did the temperature increase at the fastest rate?

---

2. In which month did the temperature peak?

---

3. What happened to the temperature between May and June?

---

4. What was the overall trend from January through May?

LIVEWORKSHEETS

NAME: _____NO. ___ M.4/__

UNIT 2: READING GRAPH AND CHART

Breakdown of Daily Energy Sources for a Modern Eco-City

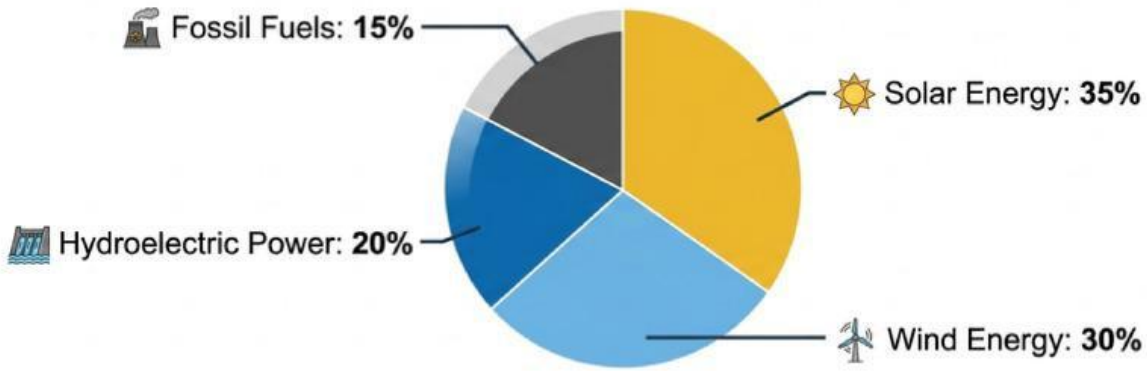

1. What proportion of the city's energy comes from renewable sources (Solar, Wind, Hydro)?

---

2. Which single source accounts for nearly one-third (33.3%) of the total energy supply?

---

3. The percentage of Solar Energy exceeds Fossil Fuels by how much?

---

4. "Hydroelectric power generates more energy than Solar." (True or False)

University Student Body Budget Allocation ($100,000 Total)

(Pie Chart based on percentage breakdown)

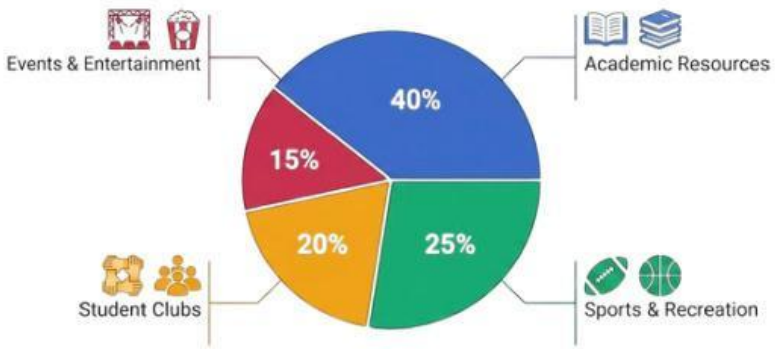

1. Which sector receives the largest portion of the budget?

---

2. How much money (in USD) is allocated to Student Clubs?

---

3. What combined percentage of the budget goes to Sports & Recreation and Events & Entertainment?

---

4. If the total budget were increased to $200,000, how much would be spent on Academic Resources (40%)?

LIVEWORKSHEETS

NAME: _____ NO. ___ M.4/__

UNIT 2: READING TABLE

INTERNATIONAL FLIGHT SCHEDULE & TRAVEL INFORMATION FROM BANGKOK (BKK)

Destination	Flight No.	Departure Time	Travel Duration	Airline	Ticket Price (THB)	Free Baggage Allowance	On-Time Rate (%)
Tokyo (NRT)	TG 676	07:35	6h 10m	THAI AIRWAYS	18,500	30 kg	92%
Singapore (SIN)	SQ 705	09:45	2h 25m	SINGAPORE AIRLINES	8,200	25 kg	95%
London (LHR)	BA 010	11:05	12h 45m	BRITISH AIRWAYS	34,000	23 kg	81%
Seoul (ICN)	XJ 700	02:10	5h 30m	AirAsia X	9,500	None (Extra Fee)	78%
Sydney (SYD)	QF 296	18:00	9h 15m	QANTAS AIRWAYS	28,900	30 kg	88%
Dubai (DXB)	EK 385	01:05	6h 35m	Emirates	22,000	35 kg	94%

*Note: Prices are for one-way economy class tickets.
*On-Time Rate indicates the percentage of flights that arrive without delay over the past year.

1. What is the main title of this table?

---

2. Which flight departs from Bangkok early in the morning at 01:05?

---

3. Which airline allows passengers to carry the heaviest free baggage?

---

4. How long does it take to fly from Bangkok to Sydney?

5.Which flight is operated by AirAsia X?

6.If a traveler wants to spend the LEAST amount of money on a ticket, which destination should they choose?

7.Which airline has the highest On-Time Rate according to the survey data?

8.A business traveler prioritizes punctuality (arriving on time) and needs to carry 32 kg of equipment without paying extra baggage fees. Which airline is the BEST choice?

LIVEWORKSHEETS