Count & Compare

1



2

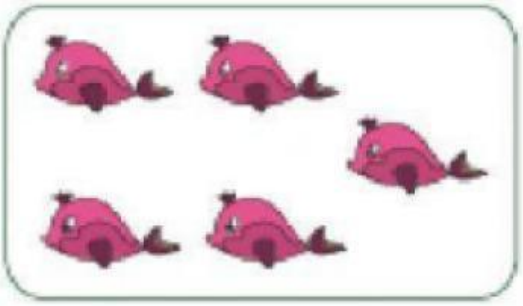

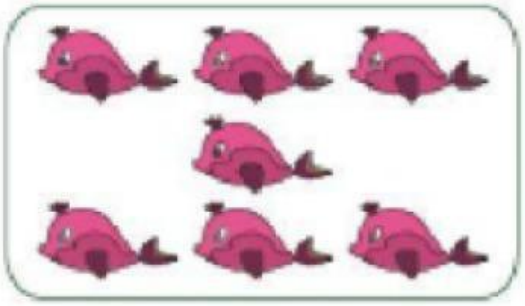

3

4



5





LIVEWORKSHEETS

Use the ruler to measure the school items to the nearest inch.

_____ inches

_____ inches

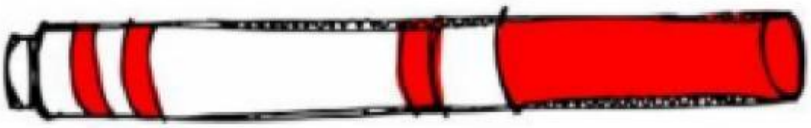

_____ inches

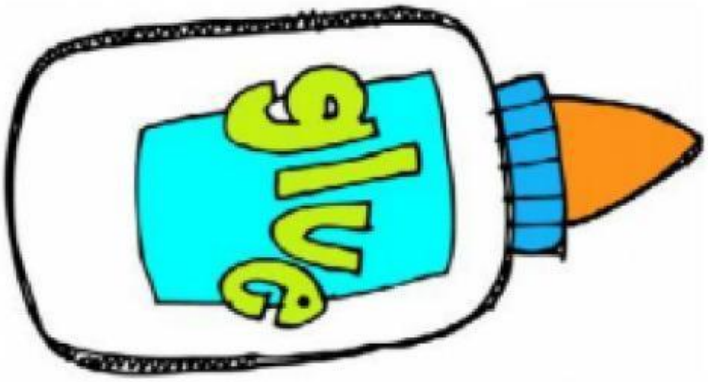

_____ inches

LIVEWORKSHEETS

Select the correct number by looking at how many tens and ones there are.

Tens Ones 10 12 1	Tens Ones 10 1 0	Tens Ones 1 11 10	Tens Ones 10 15 5
Tens Ones 10 12 2	Tens Ones 10 3 13	Tens Ones 10 6 0	Tens Ones 7 17 10
Tens Ones 10 14 4	Tens Ones 10 14 4	Tens Ones 6 16 20	Tens Ones 10 19 20

LIVEWORKSHEETS