MODUL PERSEDIAAN UJIAN AKHIR SESI AKADEMIK 4

SKOR
100

Masa: 1 Jam

Bahagian A
[26 *markah*]
Jawab **semua** soalan.

1. Tulis 328 dalam perkataan.
Write 328 in words.

[1 *markah*/1 *mark*]

2. Bundarkan 493 kepada puluh terdekat.
Round off 493 to the nearest ten.

[1 *markah*/1 *mark*]

3. (a) Lengkapkan pola nombor.
Complete the number pattern.

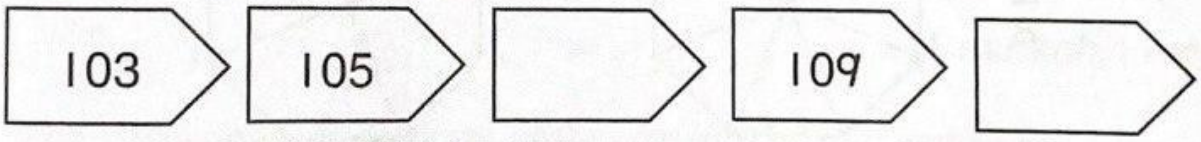

[2 *markah*/2 *marks*]

(b) Tandakan (✓) pola nombor yang betul dalam (a).
Tick (✓) the correct number pattern in (a).

Menurun dua-dua *Decreasing in twos*	
Menaik dua-dua *Increasing in twos*	

[1 *markah*/1 *mark*]

LIVEWORKSHEETS

(b) Jadual di bawah menunjukkan bilangan reben yang digunakan untuk mengikat hadiah. Lengkapkan jadual itu.
The table below shows the number of ribbons used to tie presents. Complete the table.

Reben *Ribbon*	Gundal *Tally*	Bilangan gulung *Number of rolls*
Merah *Red*	卌 ||||	
Hijau *Green*		6

[2 *markah*/2 *marks*]

(c) Tandakan (✓) pada cara mengukur reben yang betul.
Tick (✓) the correct method to measure a ribbon.



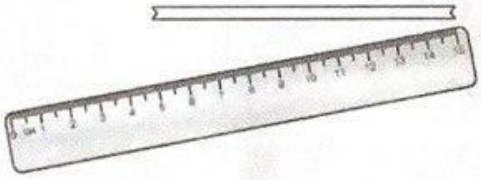

[1 *markah*/1 *mark*]

(d) 18 gulung reben dibahagikan sama banyak antara Laila, Mei Ling dan Siva. Berapa gulung rebenkah setiap orang murid dapat?
18 *rolls of ribbon are divided equally among Laila, Mei Ling and Siva. How many rolls of ribbon does each pupil get?*

[3 *markah*/3 *marks*]

LIVEWORKSHEETS

8. Lorek rajah di bawah mengikut nilai perpuluhan yang diberi.
Shade the diagram according to the decimal given.

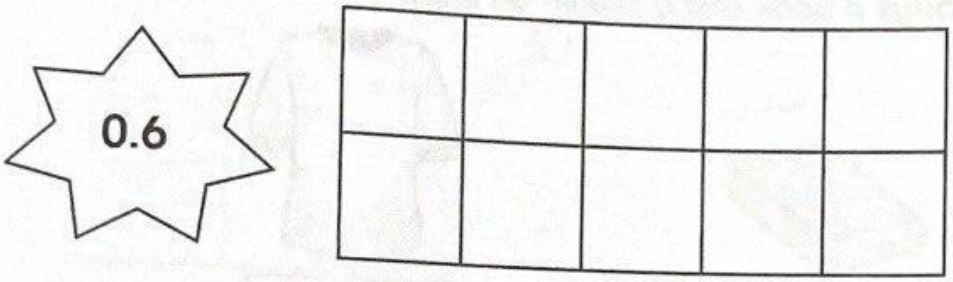

[1 *markah*/1 *mark*]

9. Muka jam di bawah menunjukkan Samy tiba di rumah dari sekolah.
The clock face shows the time Samy reached home from school.



(a) Tulis waktu itu dalam angka.
Write the time in numerals.

[1 *markah*/1 *mark*]

(b) Pukul berapakah selepas setengah jam? Tulis waktu itu dalam angka dan perkataan.
What is the time after half an hour? Write the time in numerals and words.

Angka *Numerals*	
Perkataan *Words*	

[2 *markah*/2 *marks*]

LIVEWORKSHEETS

Bahagian B

[14 *markah*]

Jawab **semua** soalan.

1. Jenny pergi ke sebuah bakeri untuk membeli kek.
Jenny goes to a bakery to buy cakes.

(a) Bakeri itu menghasilkan 127 kek coklat dan 105 kek strawberi dalam seminggu. Berapakah bilangan kek yang dihasilkan kesemuanya?
The bakery produced 127 chocolate cakes and 105 strawberry cakes in a week. How many cakes were produced altogether?

[2 *markah*/2 *marks*]

(b) Rajah di bawah menunjukkan kek coklat.
The diagram shows a chocolate cake.

(i) Namakan bentuk 3D bagi kek coklat itu.
Name the 3-D shape of the chocolate cake.

[1 *markah*/1 *mark*]

(ii) Nyatakan ciri-ciri bentuk 3D bagi kek coklat itu.
State the characteristics of the 3-D shape of the chocolate cake.

Bilangan sisi lurus ***Number of straight lines***	
Bilangan bucu ***Number of vertices***	

[2 *markah*/2 *marks*]

LIVEWORKSHEETS

(c)



RM38

RM46

Jenny membeli sebiji kek coklat dan sebiji kek strawberi. Dia membayar dengan RM100. Berapakah baki wangnya?
Jenny bought a chocolate cake and a strawberry cake. She paid with RM100. *What is her balance?*

[2 *markah*/2 *marks*]

2. Nora ada reben merah dan reben hijau.
Nora has red ribbon and green ribbon.

(a) Anggarkan panjang pensel.
Estimate the length of the pencil.

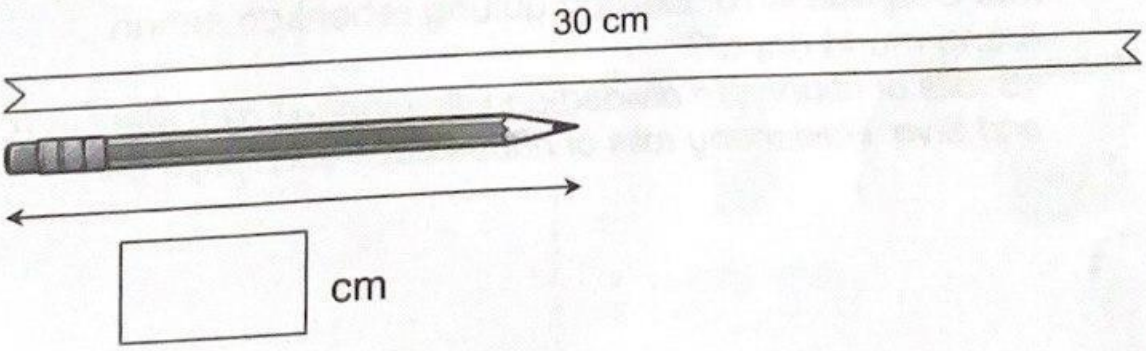

[1 *markah*/1 *mark*]

LIVEWORKSHEETS

10. Erica beli sebuah buku dan sehelai kemeja-T seperti dalam rajah di bawah.
Erica buys a book and a T-shirt as shown in the diagram.

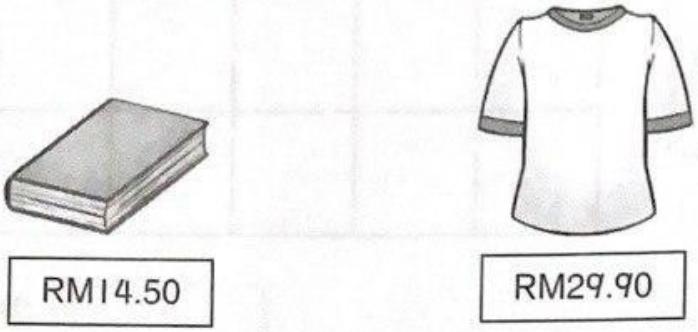

Erica bayar dengan sekeping wang kertas RM50.
Kira baki wangnya.
Erica pays with a piece of RM50 *note. Calculate her balance.*

[2 *markah*/2 *marks*]

11. Tulis jisim objek yang betul.
Write the correct masses of the objects.

(a)

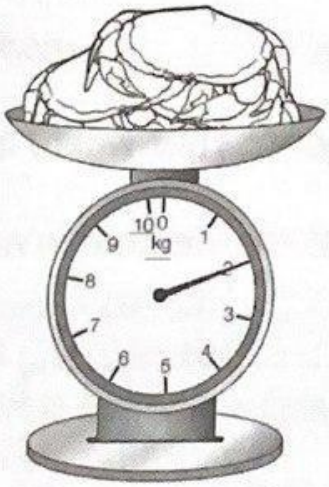

(b)

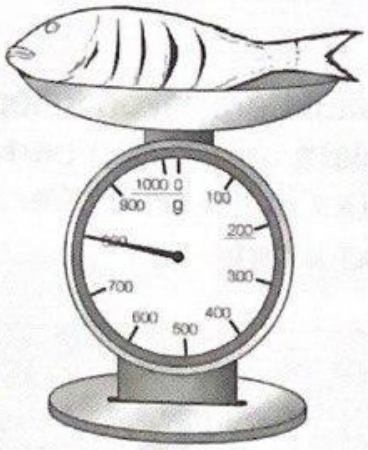

[2 *markah*/2 *marks*]

LIVEWORKSHEETS

12. Namakan bentuk 3D bagi setiap bentangan di bawah.
Name the 3-D shape for each net below.

(a)



(b)

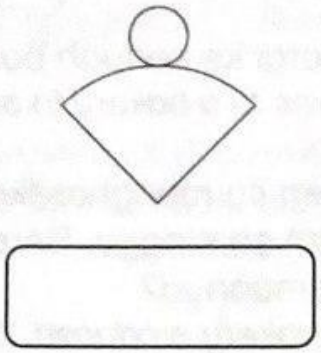

[2 *markah*/2 *marks*]

13. Lihat carta palang di bawah. Isi tempat kosong.
Look at the bar chart. Fill in the blanks.

Buah Kegemaran 30 Orang Murid
Favourite Fruits of 30 Pupils

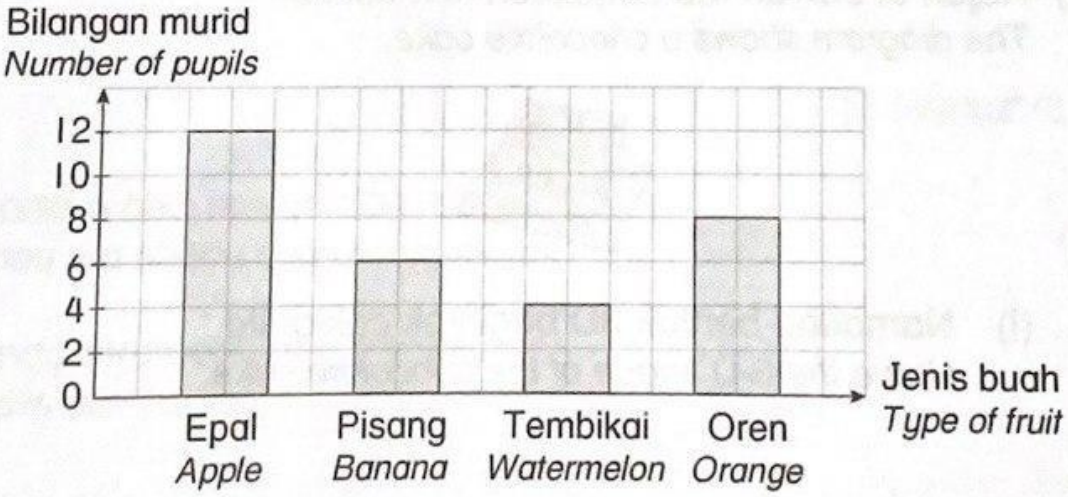

(a) _____ orang murid yang gemar pisang.

_____ *pupils like banana.*

(b) _____ ialah buah yang paling digemari.

_____ *is the most favourite fruit.*

(c) Buah yang kurang digemari ialah _____ .

The least favourite fruit is _____ .

[3 *markah*/3 *marks*]

LIVEWORKSHEETS

4. Kira jumlah bagi 19, 6 dan 312.
Calculate the total of 19, 6 and 312.

[2 *markah*/2 *marks*]

5. 862 – 37 = ☐

[2 *markah*/2 *marks*]

6. Lorek setiap rajah ikut pecahan yang diberi. Kemudian, bulatkan pecahan yang lebih besar.
Shade each diagram according to the fraction given. Then, circle the larger fraction.

$\frac{5}{8}$

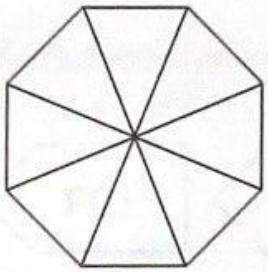

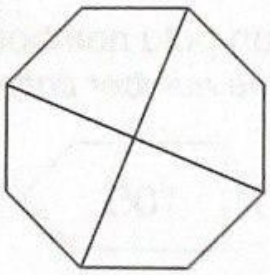

$\frac{3}{4}$

[2 *markah*/2 *marks*]

7. Satu bakul ada 5 biji oren. Berapakah jumlah bilangan oren di dalam 6 bakul yang sama?
One basket has 5 oranges. How many oranges are there in 6 similar baskets?

[2 *markah*/2 *marks*]

LIVEWORKSHEETS