Exercise 4 Study this melody and then answer the questions that follow.



a Compare the following to bar 1 of the melody, then tick (✔) the single correct statement.

A 

B 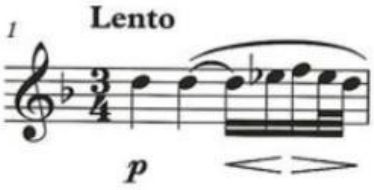

C 

A is an exact copy ☐ B is an exact copy ☐

C is an exact copy ☐ They are all different from the original ☐

b Circle **TRUE** or **FALSE**.

The melody ends on the 5th degree of D minor. **TRUE** **FALSE**

c Complete the following **three** sentences by ticking (✔) **one** box for each.

(i) There are demisemiquavers in ...

bars 1 and 2 ☐ bars 2 and 3 ☐ bars 3 and 4 ☐ bars 4 and 5 ☐

(ii) The bar that contains the first five degrees of the scale of D minor, ascending, is ...

bar 3 ☐ bar 5 ☐ bar 6 ☐ bar 7 ☐

(iii) A dotted quaver can be found in ...

bar 5 ☐ bar 6 ☐ bar 7 ☐ bar 8 ☐

LIVEWORKSHEETS