Rearranging Formulae

For each picture, complete the equations to describe it:



4x + g = 2z

2z =

g =

x = _____

3x + g + g = 3p

x = _____

2g =

g = _____

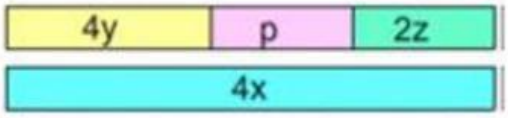

4y + p + 2z = 4x

p =

z = _____

2y = _____



4x = 2p + p + 4y

3p =

8x =

2y = _____



8x + 2z = 3t + 6y

2z =

3y = _____

x = _____



8f + 2z = 2p + p + 4y

f = _____

z = _____

4y + p =

LIVEWORKSHEETS