Exercise 5 Name the major key and the technical name for each of these notes.

a 

D major

leading note

b

c 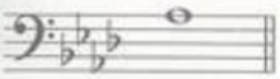

d

e 

f 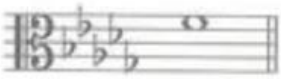

g

h

LIVEWORKSHEETS