LKPD Matematika

Kelas

3

Nama: _____

Kelas: _____

LIVEWORKSHEETS

SOAL PILIHAN GANDA

Nama ----------

Kelas ----------

Kerjakan dan pilih jawaban yang paling benar.

01 Hasil dari 25 + 17 adalah ...

A. 32 **C.** 45

B. 42 **D.** 50

02 Adi memiliki 32 kelereng. Ia membeli lagi 27 kelereng di toko. Jumlah kelereng adi menjadi...

A. 57 **C.** 59

B. 58 **D.** 6

03 Ibu membeli 15 apel. Kemudian dimakan 4 apel. Sisa apel adalah ...

A. 9 **C.** 11

B. 10 **D.** 12

LIVEWORKSHEETS

SOAL ESAY

NAMA : KELAS :

PETUNJUK : Bacalah setiap soal dengan saksama. Tulis jawaban yang benar di kotak.

Sarah memetik 7 buah apel. Kakaknya memberinya 5 buah apel lagi. Berapa banyak apel yang dimilikinya sekarang?

Ada 20 siswa di dalam bus. 8 siswa turun. Berapa banyak siswa yang tersisa di dalam bus?

Emma memiliki 3 ekor anjing. Ia memberikan 4 camilan untuk setiap anjing.
Berapa banyak camilan yang ia berikan secara total?

LIVEWORKSHEETS

Nama: _____ Kelas: _____

MARI MENJODOHKAN

Hitung jumlah kue dan buah pada setiap soal,lalu tarik garis untuk mencocokkannya dengan hasil yang sesuai!



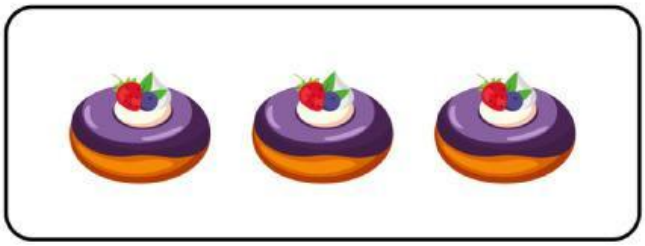





- 2
- 3
- 4
- 5
- 6

LIVEWORKSHEETS

Nama: _____

Kelas: _____

MENGELOMPOKKAN BANGUN DATAR DAN RUANG

Tulislah mana saja yang termasuk bangun ruang dan datar.


Persegi

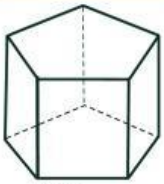
Prisma

Persegi Panjang

Kerucut


Lingkaran

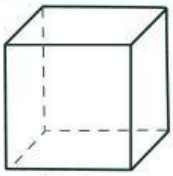
Kubus

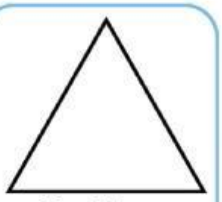
Segitiga

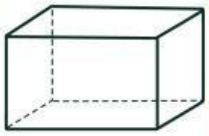
Tabung

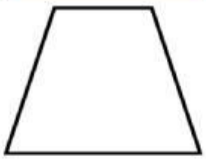
Trapesium

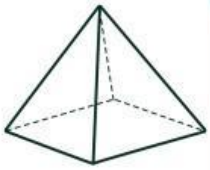
Limas

Layang layang

Bola

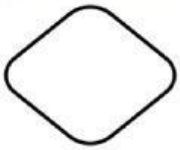
Belah Ketupat

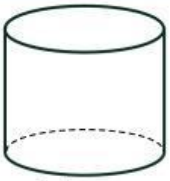
Limas

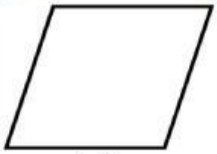
Jajar Genjang

Bangun Datar

1. _____
2. _____
3. _____
4. _____
5. _____
6. _____

Bangun Ruang

1. _____
2. _____
3. _____
4. _____
5. _____
6. _____

LIVEWORKSHEETS