LKPD
Matematika

Tema: Pengukuran Panjang dan Berat

Nama: _____

Kelas: _____

LIVEWORKSHEETS

Alat Ukur

Hubungkan gambar di bawah ini dengan fungsinya yang sesuai.

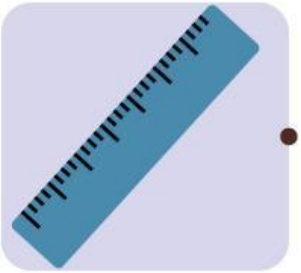

- Alat Ukur Panjang
- Alat Ukur Berat

LIVEWORKSHEETS

Mengukur Panjang

Tulislah panjang benda pada tabel di bawah ini.

No.	Pengukuran Panjang Benda	Panjang benda dengan satuannya.
1.		
2.	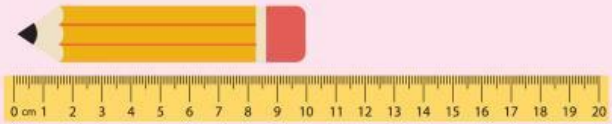	
3.		
4.	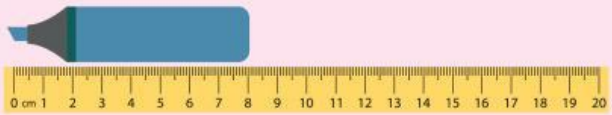	
5.		
6.		
7.		

LIVEWORKSHEETS

Menghitung Berat

Hitunglah penjumlahan berat buah di bawah ini.

+

= _____

+

= _____

+



= _____

+

= _____

LIVEWORKSHEETS