NAMA : _____ KELAS : _____

PECAHAN

Lingkari pecahan yang sesuai dengan bagian yang diarsir pada setiap bentuk dari pilihan yang tersedia.

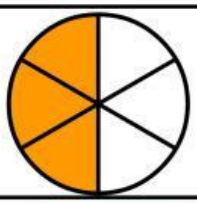	$\frac{1}{6}$	$\frac{3}{4}$	$\frac{2}{4}$	$\frac{3}{6}$	$\frac{2}{6}$
	$\frac{3}{5}$	$\frac{4}{5}$	$\frac{5}{6}$	$\frac{3}{5}$	$\frac{4}{6}$
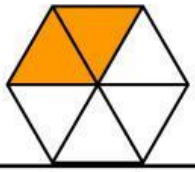	$\frac{1}{6}$	$\frac{2}{6}$	$\frac{2}{7}$	$\frac{3}{6}$	$\frac{2}{5}$
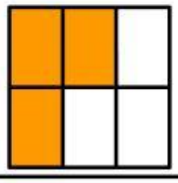	$\frac{3}{8}$	$\frac{2}{6}$	$\frac{3}{3}$	$\frac{2}{8}$	$\frac{3}{6}$
	$\frac{6}{8}$	$\frac{5}{6}$	$\frac{6}{4}$	$\frac{5}{8}$	$\frac{4}{6}$
	$\frac{4}{8}$	$\frac{5}{7}$	$\frac{2}{8}$	$\frac{3}{7}$	$\frac{2}{7}$

LIVEWORKSHEETS

NAMA : _____ KELAS : _____

MENGHUBUNGKAN PECAHAN

Hubungkan gambar pizza dengan angka pecahan yang tepat dan benar!

$\frac{1}{3}$

$\frac{3}{6}$

$\frac{2}{10}$

$\frac{1}{2}$

$\frac{1}{9}$

$\frac{3}{7}$

LIVEWORKSHEETS

NAMA : _____ KELAS : _____

PENGURANGAN PECAHAN

Kerjakanlah operasi hitung pecahan berikut ini dengan tepat!



$- \quad = \frac{\square}{\square} - \frac{\square}{\square} = \frac{\square}{\square}$

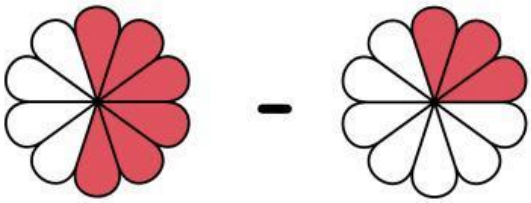

$- \quad = \frac{\square}{\square} - \frac{\square}{\square} = \frac{\square}{\square}$

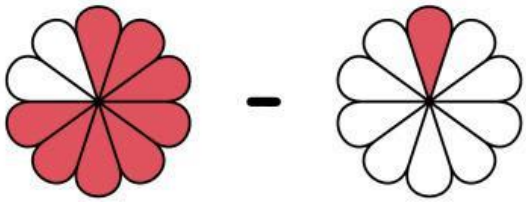

$- \quad = \frac{\square}{\square} - \frac{\square}{\square} = \frac{\square}{\square}$

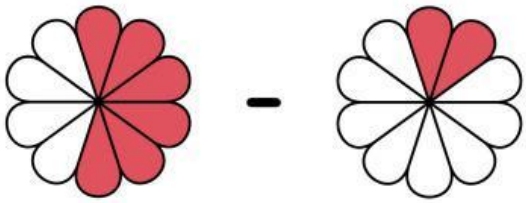

$- \quad = \frac{\square}{\square} - \frac{\square}{\square} = \frac{\square}{\square}$

LIVEWORKSHEETS

NAMA : _____ KELAS : _____

PECAHAN ARSIRAN

Perhatikan gambar di bawah ini kemudian tentukan nilai pecahan yang tepat!

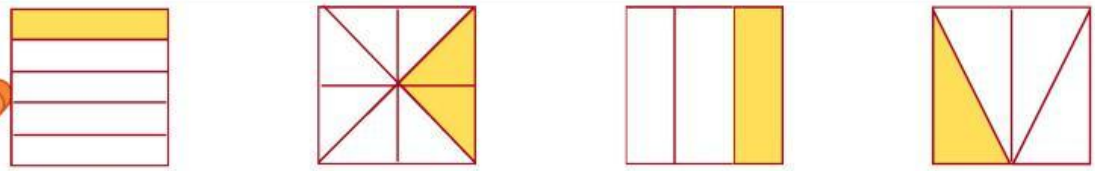

$\frac{\square}{\square}$ $\frac{\square}{\square}$ $\frac{\square}{\square}$ $\frac{\square}{\square}$

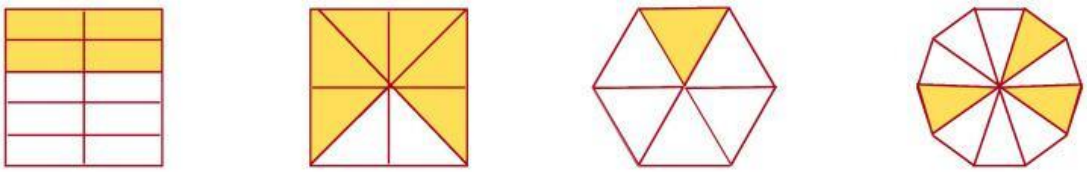

$\frac{\square}{\square}$ $\frac{\square}{\square}$ $\frac{\square}{\square}$ $\frac{\square}{\square}$

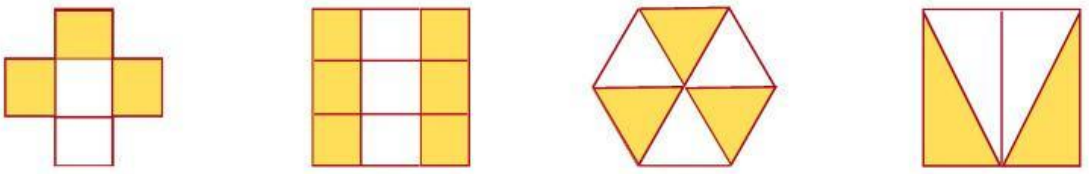

$\frac{\square}{\square}$ $\frac{\square}{\square}$ $\frac{\square}{\square}$ $\frac{\square}{\square}$

LIVEWORKSHEETS

NAMA : _____ KELAS : _____

MEMBANDINGKAN PECAHAN

Amati dua gambar lingkaran pecahan. Tentukan pecahan yang lebih besar, lebih kecil atau sama dengan melihat bagian yang diarsir. Gunakan tanda perbandingan (>, <, =) di antara kedua pecahan tersebut.

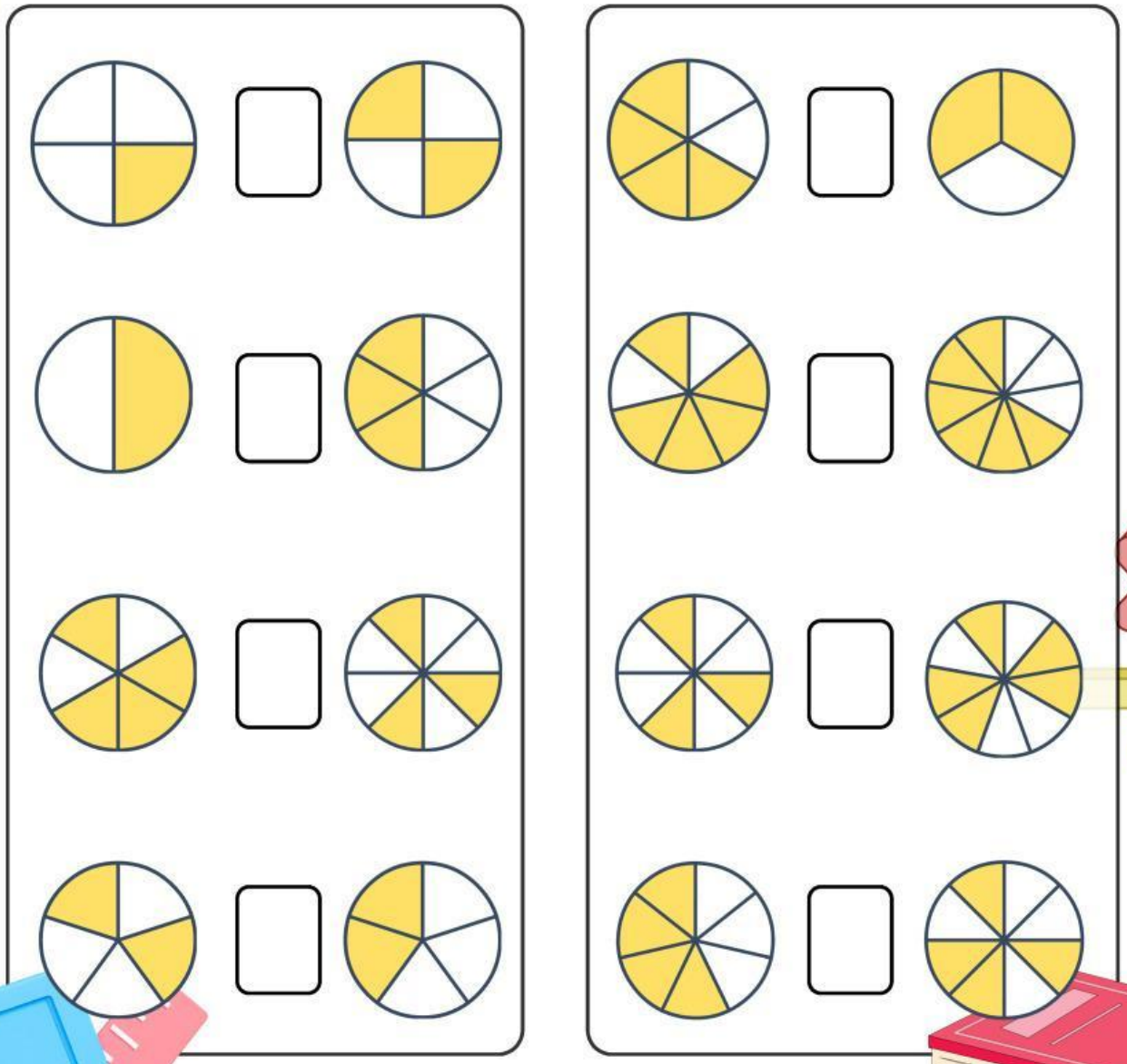

LIVEWORKSHEETS

NAMA : _____ KELAS : _____

PENJUMLAHAN PECAHAN

Kerjakanlah operasi hitung pecahan berikut ini dengan tepat!

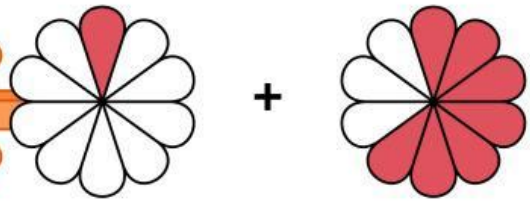

$+ \quad = \frac{\square}{\square} + \frac{\square}{\square} =$

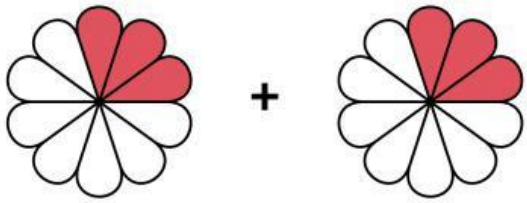

$+ \quad = \frac{\square}{\square} + \frac{\square}{\square} =$

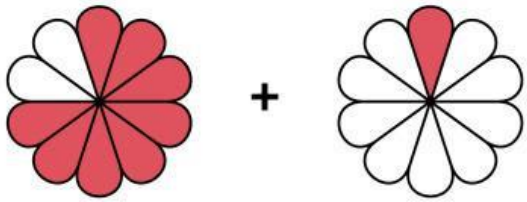

$+ \quad = \frac{\square}{\square} + \frac{\square}{\square} =$

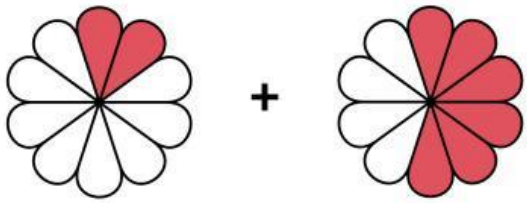

$+ \quad = \frac{\square}{\square} + \frac{\square}{\square} =$

LIVEWORKSHEETS

NAMA : _____ KELAS : _____

PECAHAN SENILAI

Isilah titik-titik di bawah ini dengan bilangan pecahan sesuai derah yang diarsir!

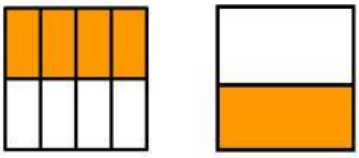

$\frac{4}{8} = \frac{1}{2}$

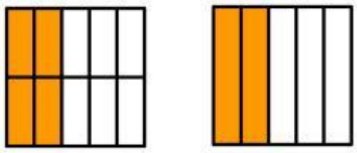

$\frac{\square}{\square} = \frac{\square}{\square}$

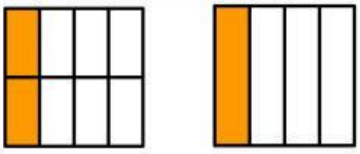

$\frac{\square}{\square} = \frac{\square}{\square}$

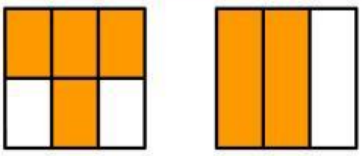

$\frac{\square}{\square} = \frac{\square}{\square}$

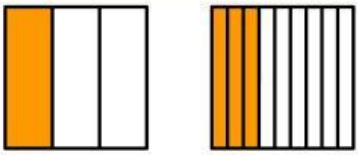

$\frac{\square}{\square} = \frac{\square}{\square}$

Contoh :

$\frac{4}{8}$ **senilai dengan** $\frac{1}{2}$ **karena** $\frac{4}{8}$ **sama-sama dibagi 4 pada bagian penyebut dan pembilangnya.**

LIVEWORKSHEETS

NAMA : _____ KELAS : _____

MENGENAL PECAHAN

Tulislah pecahan dengan menuliskan jumlah bagian yang diarsir pada kotak atas (pembilang) dan jumlah seluruh bagian pada kotak bawah (penyebut)!

$\frac{1}{4}$

$\frac{\square}{\square}$

$\frac{\square}{\square}$

$\frac{\square}{\square}$

$\frac{\square}{\square}$

$\frac{\square}{\square}$

$\frac{\square}{\square}$

$\frac{\square}{\square}$

$\frac{\square}{\square}$

$\frac{\square}{\square}$

$\frac{\square}{\square}$

$\frac{\square}{\square}$

$\frac{\square}{\square}$

LIVEWORKSHEETS