ใบงาน
เรื่อง ภาพฉาย

ชื่อ-นามสกุล..... ชั้น.....เลขที่.....

คำชี้แจง จากภาพสามมิติ A – E ที่กำหนดให้ จงหาภาพด้านหน้า ด้านข้างและด้านบน และเขียนหมายเลขลงในตารางด้านล่าง (15 คะแนน)

A

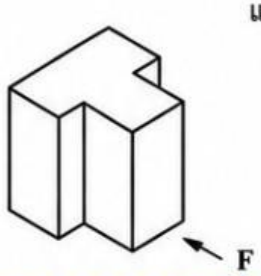

B

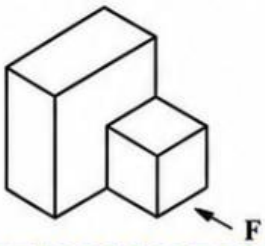

C

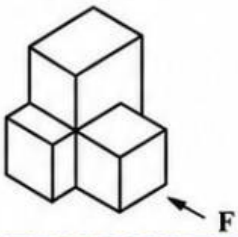

D

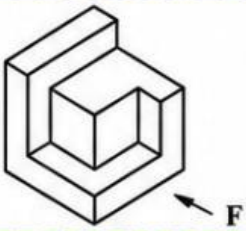

E

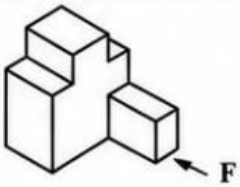

1


2
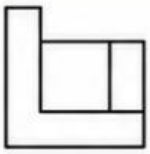

3


4
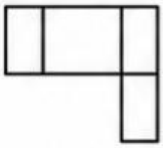

5
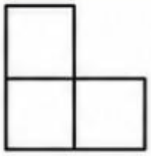

6


7


8

9
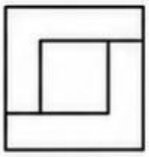

10
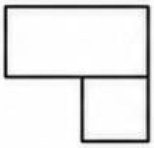

11
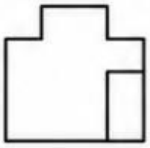

12
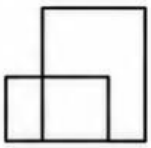

13
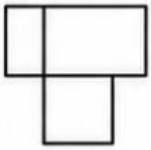

14


15


View	A	B	C	D	E
ภาพด้านหน้า (Front View)					
ภาพด้านข้าง (Side View)					
ภาพด้านบน (Top View)					

คะแนนที่ได้..... / 15 คะแนน ☐ ผ่านเกณฑ์ ☐ ไม่ผ่านเกณฑ์

LIVEWORKSHEETS