TRIGONOMETRIC RATIOS

Choose correct option from drop down

1

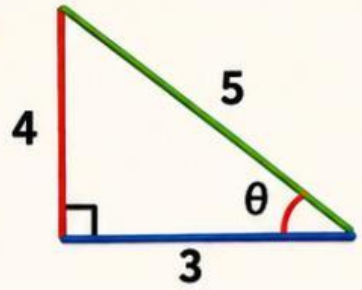

The length of the opposite leg is → ▾

The length of the adjacent leg is → ▾

The length of the hypotenuse is → ▾

2

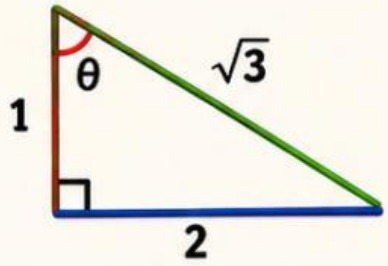

The length of the opposite leg is → ▾

The length of the adjacent leg is → ▾

The length of the hypotenuse is → ▾

3

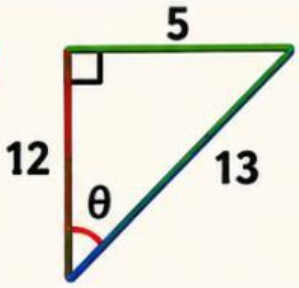

The length of the opposite leg is → ▾

The length of the adjacent leg is → ▾

The length of the hypotenuse is → ▾

4

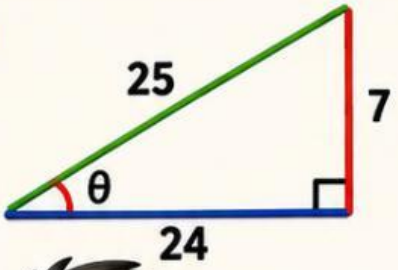

The length of the opposite leg is → ▾

The length of the adjacent leg is → ▾

The length of the hypotenuse is → ▾

Ramaswamy Kodam

LIVEWORKSHEETS