Dužina kružnog luka i površina kružnog isečka

Ako je poluprečnik svake kružnice 30 cm, upiši kolika je dužina kružnog luka i površina kružnog isečka.

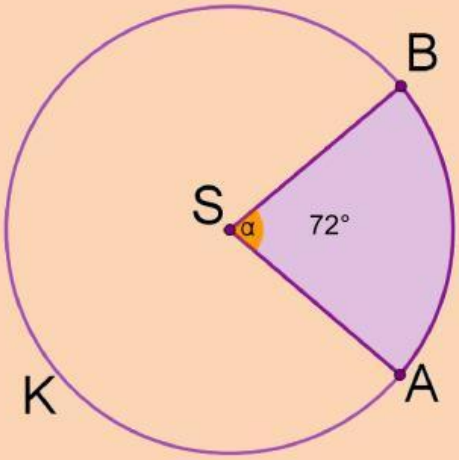

l= $\pi\ cm$
P= $\pi\ cm^2$

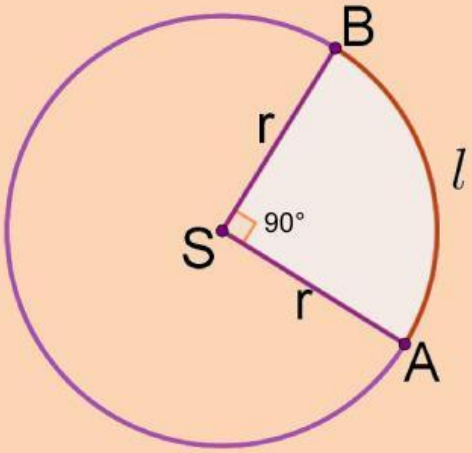

l= $\pi\ cm$
P= $\pi\ cm^2$

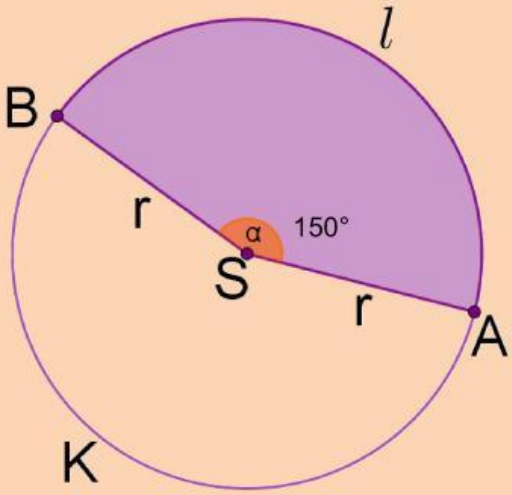

l= $\pi\ cm$
P= $\pi\ cm^2$

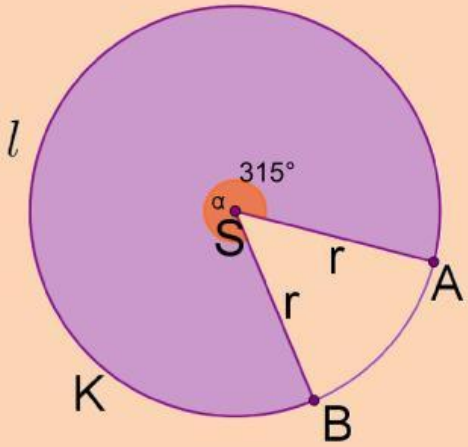

l= $\pi\ cm$
P= $\pi\ cm^2$

LIVEWORKSHEETS