BANGUN RUANG
SISI DATAR

Kubus

- Luas Permukaan

6 x s x s

- Volume

s x s x s

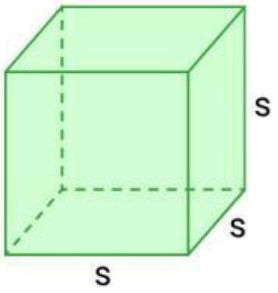

Contoh

- Luas Permukaan

6 x 3 x ____ = ____

- Volume

3 x ____ x ____ = ____

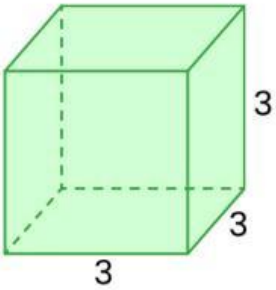

Balok

- Luas Permukaan

2 x (pl+ pt + lt)

- Volume

p x l x t

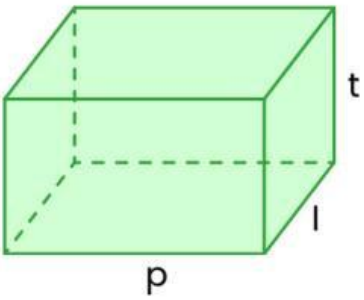

LIVEWORKSHEETS

BANGUN RUANG
SISI DATAR

Contoh

- Luas Permukaan

2 x (20 + ____ + ____ = ____

- Volume

5 x ____ x ____ = ____

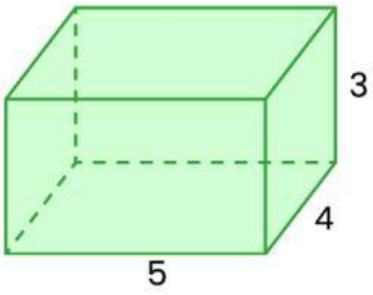

Prisma

- Luas Permukaan

(2 x L.Alas) + (K.Alas x t)

- Volume

L.Alas x t

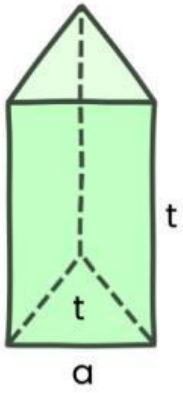

Contoh

- Luas Permukaan

(2 x 6) + (..... x 6) = ____

- Volume

6 x ____ = ____

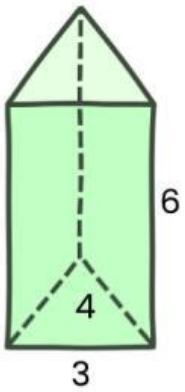

LIVEWORKSHEETS

BANGUN RUANG
SISI DATAR

Limas

- Luas Permukaan

L.Alas + L.Sisi Tegak

- Volume

1/3 x L.Alas x t

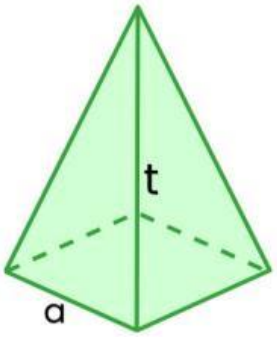

Contoh

- Luas Permukaan

16 + _____ = _____

- Volume

1/3 x 16 x _____ = _____

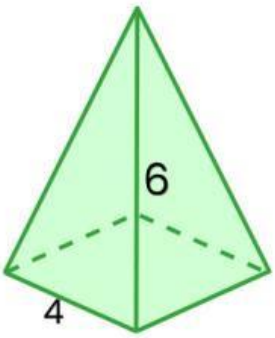

LIVEWORKSHEETS

BANGUN RUANG
SISI DATAR

Pasangkan bentuk berikut

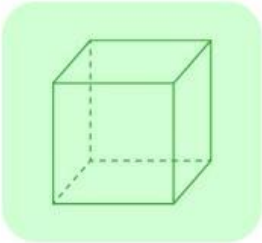

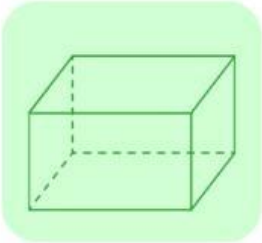

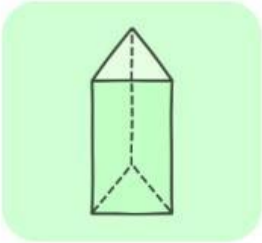

Balok

Limas

Prisma

Kubus

LIVEWORKSHEETS

BANGUN RUANG
SISI DATAR

Carilah kata-kata seputar materi

P	R	I	S	M	A	B	Q	X	Z
D	F	G	H	J	K	L	M	N	O
B	A	L	O	K	P	Q	R	S	T
U	V	W	X	Y	Z	A	B	C	D
E	F	G	H	I	J	K	L	M	N
O	P	Q	R	L	I	M	A	S	T
U	V	W	X	Y	Z	A	B	C	D
Q	R	K	U	B	U	S	E	F	G
H	I	J	K	L	M	N	O	P	Q
R	S	T	U	V	W	X	Y	Z	A

- Untuk memperkuat pemahaman kalian silahkan klik link berikut :

LIVEWORKSHEETS