Kategori: **MATEMATIKA DASAR (KELAS 4 SD)**

LEMBAR KERJA PESERTA DIDIK (LKPD)

Nama Siswa: _____

Kelas: _____ Tanggal: _____

DIAGRAM / GAMBAR	LAMBANG PECAHAN	NAMA PECAHAN
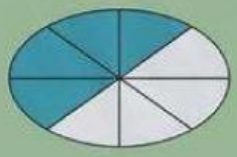	$\frac{3}{9}$	Enam persepuluh
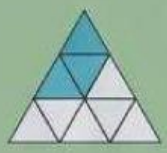	$\frac{8}{10}$	Sembilan perduabelas
	$\frac{6}{10}$	Empat pertujuh
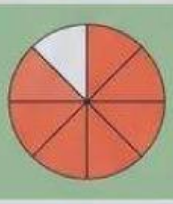	$\frac{5}{8}$	Delapan persepuluh
	$\frac{1}{3}$	Sepuluh perempat belas
	$\frac{10}{14}$	Lima perdelapan
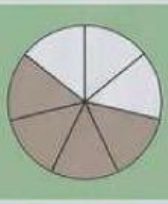	$\frac{4}{7}$	Satu pertiga
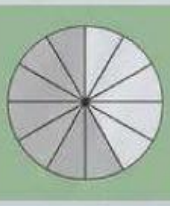	$\frac{9}{12}$	Tiga persembilan

LIVEWORKSHEETS