Picture Addition to 15

Count the objects in each group. Add and type in the sum.

1. 

2. 

3.

4. 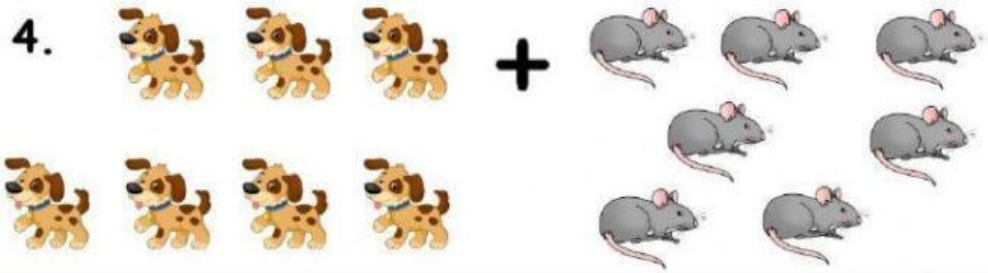

5. 

LIVEWORKSHEETS
LIVEWORKSHEETS