Write the **fraction** for each set of shapes.

1.

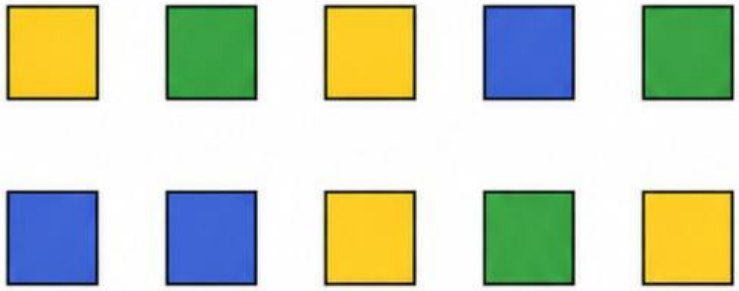

10	are yellow squares.
10	are green squares.
10	are blue squares.

2.



8	are red circles.
8	are green circles.
8	are yellow circles.

3.

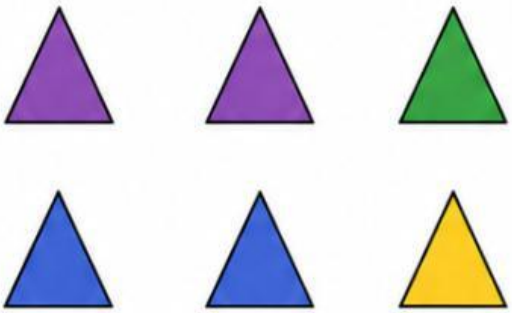

6	are purple triangles.
6	are blue triangles.
6	are green triangles.

4.

12	are orange stars.
12	are blue stars.
1[illegible]	are green stars.

LIVEWORKSHEETS